Escola: _____

Data: _____ Turma: _____

Aluno: _____

CASCÃO E CEBOLINHA POSSUEM MUITOS BRINQUEDOS. VAMOS CONTAR QUANTOS TIPOS DE BRINQUEDOS HÁ NA ESTANTE E, EM SEGUIDA, COMPLETAR AS OPERAÇÕES?

a) 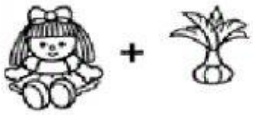 = ☐

b) 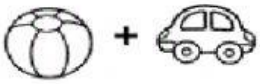 = ☐

c) = ☐

d) 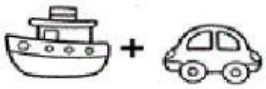 = ☐

e) 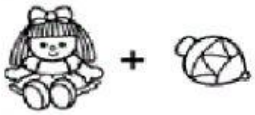 = ☐

f) = ☐

g) = ☐

h) 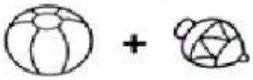 = ☐

i) = ☐

j) 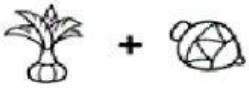 = ☐

RESPOSTA: A) 5; B) 8; C) 4; D) 5; E) 3; F) 8; G) 7; H) 5; I) 4; J) 6

COMPLETE A SEQUÊNCIA NUMÉRICA

1		3		5		7		9	10
11	12		14		16		18		20
21		23		25		27		29	30
31	32		34		36		38		40
41		43		45		47		49	50

Copyright © 2016 www.worksheetfun.com All rights reserved

LIVEWORKSHEETS

3-QUEM ESTÁ ENTRE?

3 ⟷ 5 | 7 ⟷ 9

0 ⟷ 2 | 4 ⟷ 6

6 ⟷ 8 | 1 ⟷ 3

VAMOS SOMAR?

LUCAS TINHA UMA BOLA E GANHOU MAIS UMA.
QUANTAS ELE TEM AGORA?

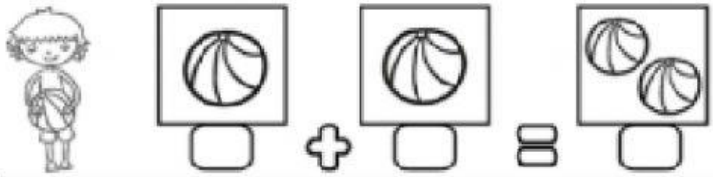

MARINA TINHA DOIS SORVETES E GANHOU MAIS UM.
QUANTOS ELA TEM AGORA?

SOMANDO COM OS DADOS

0 1 2 3 4 5 6 7 8 9



LIVEWORKSHEETS