Sahih Maya

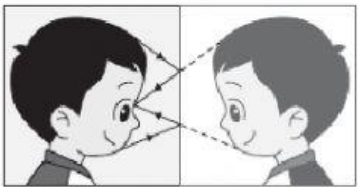

Imej _____

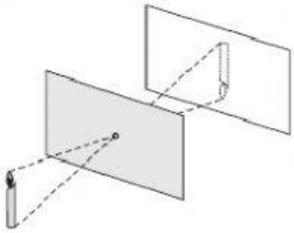

imej _____

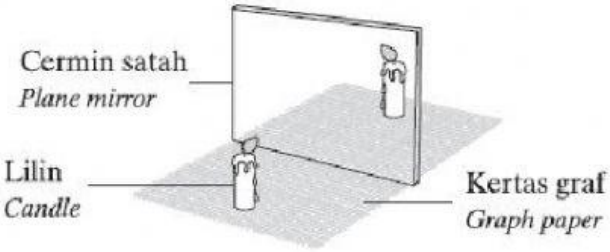

Gambar A

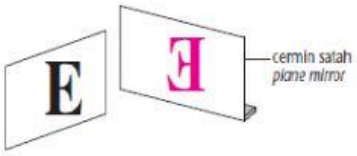

Gambar B

Ciri-ciri cermin satah :

Imej yang terhasil ialah imej _____.

Imej yang terbentuk adalah _____.

Gambar B menunjukkan imej adalah _____.

LIVEWORKSHEETS

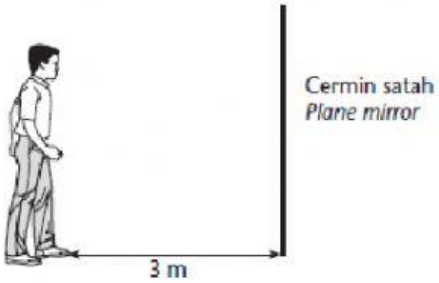

Jarak antara imej dengan murid

= _____ m

Sebab

Jarak imej dari cermin adalah _____imej objek dari cermin.

Saiz imej adalah _____saiz objek .

https://youtu.be/NLAIQ4IxxZ8

LIVEWORKSHEETS