Nama: _____ Tarikh: _____

UNIT 7: BENTUK (KENAL PRISMA DAN BUKAN PRISMA)

7 BENTUK

KENAL PRISMA DAN BUKAN PRISMA

Markah

Aktiviti 1

1 Padankan.

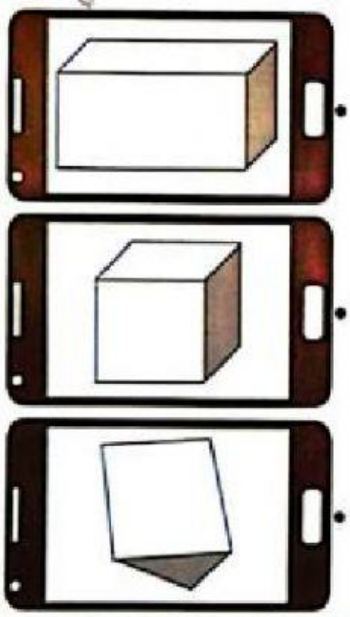

- prisma segi tiga
- prisma segi empat sama
- prisma segi empat tepat

2 Sambungkan garis putus-putus. Tulis nama prisma.

a

b

c

LIVEWORKSHEETS

Aktiviti 2

1 Isi petak kosong. Gunakan perkataan yang diberikan.

bucu | tepi | tapak | permukaan rata

a

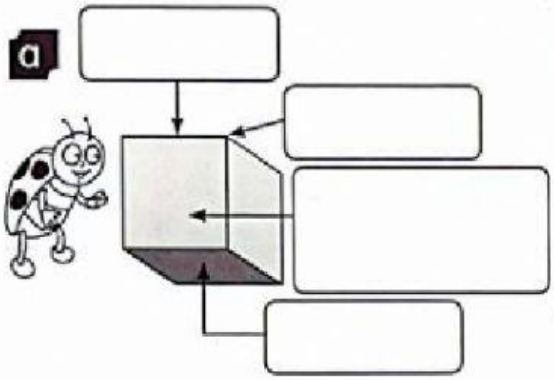

b

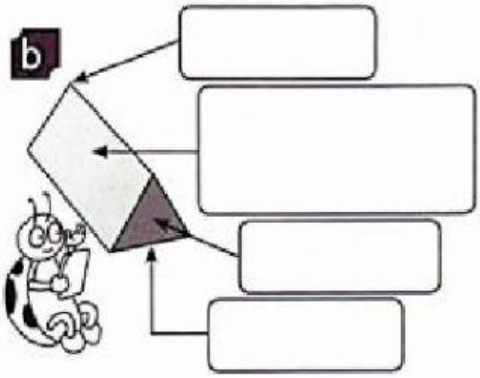

c

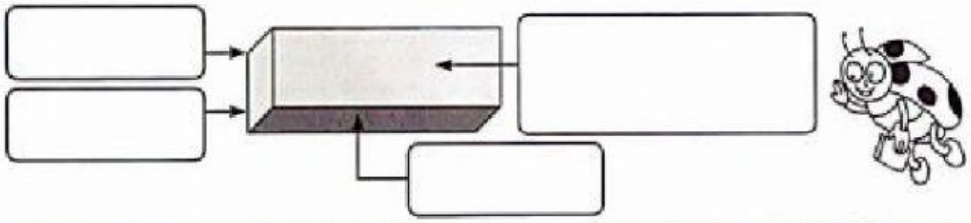

2 Lengkapkan jadual.

Bentuk prisma	Bentuk tapak	Bilangan bucu	Bilangan permukaan rata	Bilangan tepi

LIVEWORKSHEETS