แบบฝึกหัด 1.4 ปริมาตรของปริซึม 1

ชื่อ-สกุล.. .....ชั้น.....เลขที่.....

1.

สูตร ปริมาตรของปริซึม = ☐ × ☐

สูตร ปริมาตรของปริซึมสี่เหลี่ยมมุมฉาก = ☐ × ☐ × ☐

2. จากรูปที่กำหนด เติมคำตอบลงในตารางต่อไปนี้

ลำดับ	ปริซึม	พื้นที่ฐาน (ตารางหน่วย)	ปริมาตรของปริซึม (ลูกบาศก์หน่วย)
1.	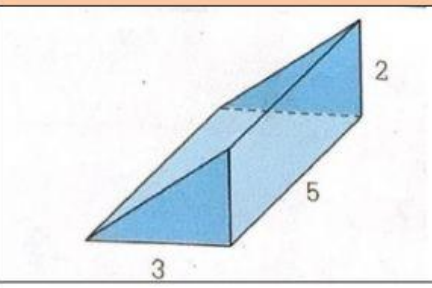		
2.	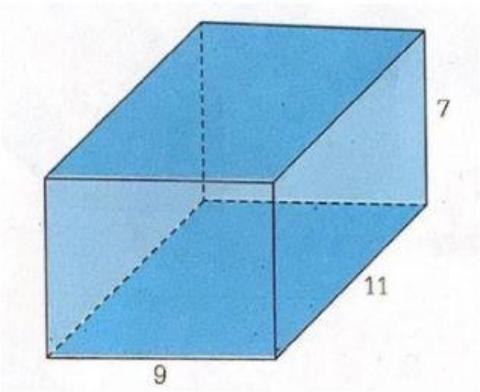		
3.	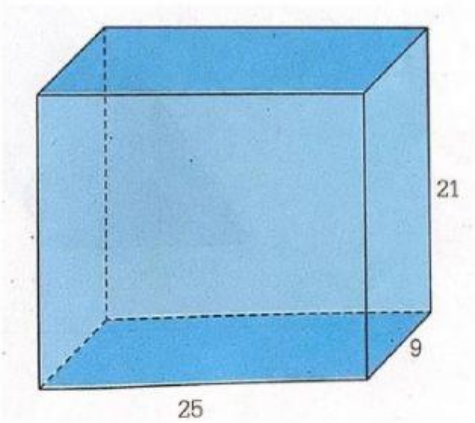		

LIVEWORKSHEETS

3. จงหาปริมาตรของปริซึมต่อไปนี้

1.

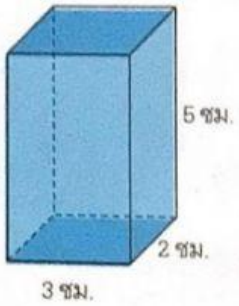

2.

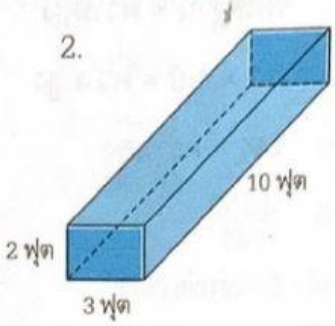

3.

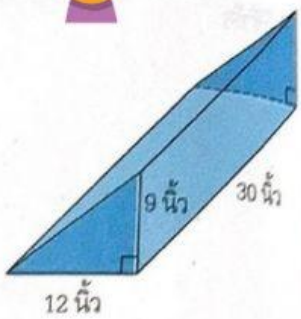

4.

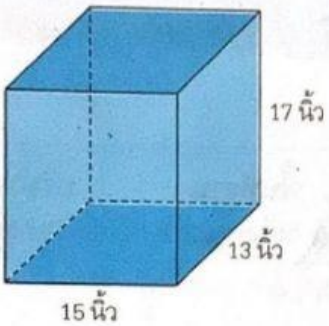

5.

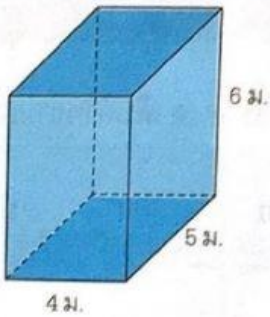

6.

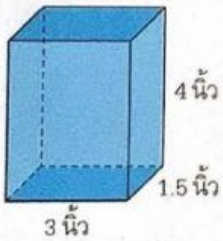

7.

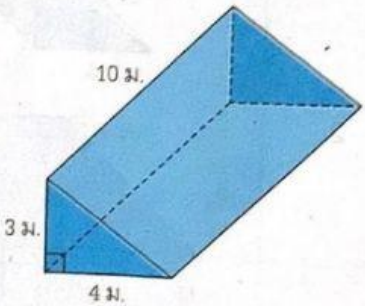

8.

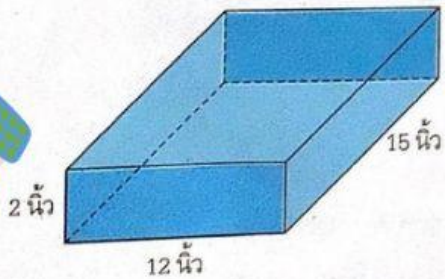

9.

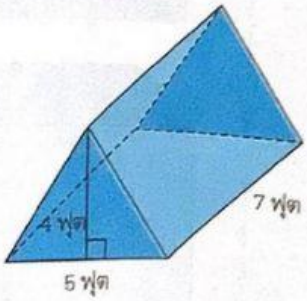

LIVEWORKSHEETS