Name _____ Date _____

Year Group _____

Measure the blue line to the nearest cm

1.

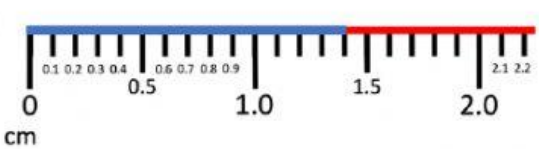

Answer = _____ cm

2.

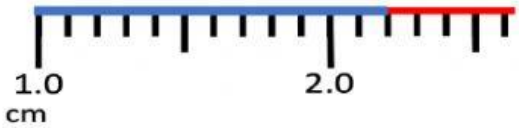

Answer = _____ cm

3.

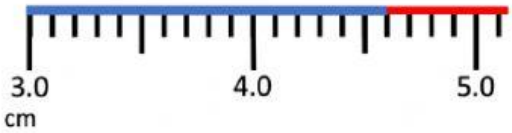

Answer = _____ cm

4.

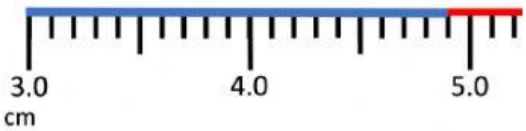

Answer = _____ cm

5.

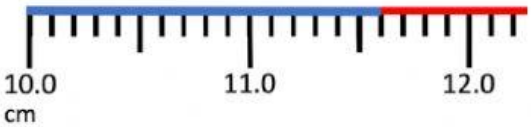

Answer = _____ cm

Measure the line to the nearest mm

6.

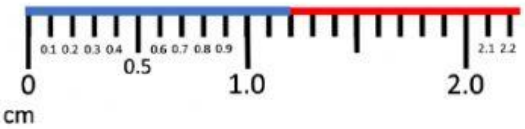

Answer = _____ mm

7.

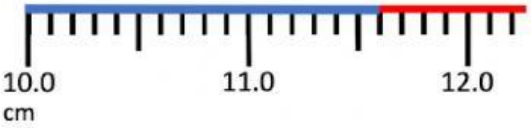

Answer = _____ mm

8.

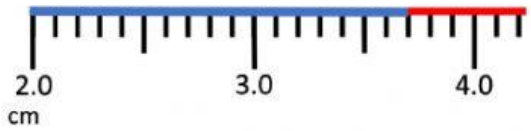

Answer = _____ mm

9.

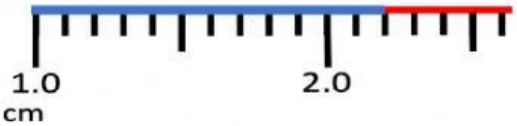

Answer = _____ mm

10.

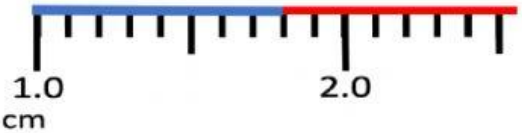

Answer = _____ mm

LIVEWORKSHEETS