ชื่อ..... นามสกุล..... เลขที่ .....ชั้น ป.1

โยงเส้นรูปที่มีค่าเท่ากันให้ถูกต้อง

5	
8	
3	
10	
4	
6	
9	
1	
7	
2	

by...Kroo_Kanita

LIVEWORKSHEETS

ชื่อ..... นามสกุล..... เลขที่ .....ชั้น ป.1

โยงเส้นรูปที่มีค่าเท่ากันให้ถูกต้อง

5	
8	
3	
10	
4	
6	
9	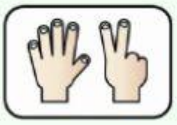
1	
7	
2	

by...Kroo_Kanita

LIVEWORKSHEETS