LEMBAR KERJA PESERTA DIDIK

NAMA :

TANGGAL :

1. Ubahlah kalimat matematika berikut ke dalam garis bilangan!

a. $-5 + 12 = 7$

b. $10 + (-8) = 2$

c. $8 - (-7) = 15$

d. $-11 - (-8) = -3$

e. $-2 + (-8) - (-7) = -3$

LIVEWORKSHEETS

PILIHAN JAWABAN

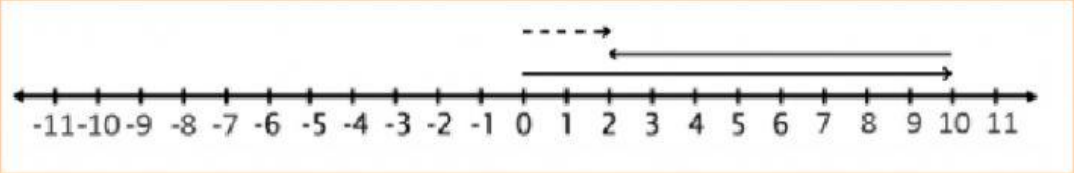

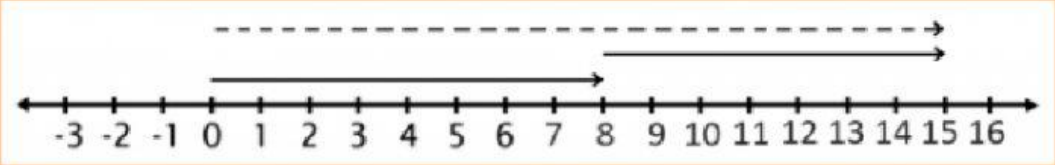

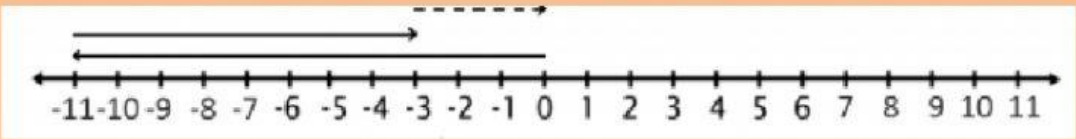

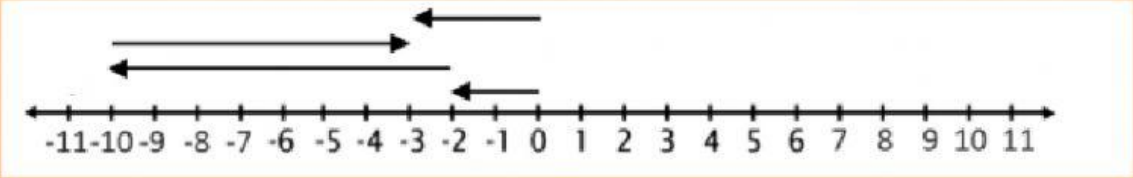

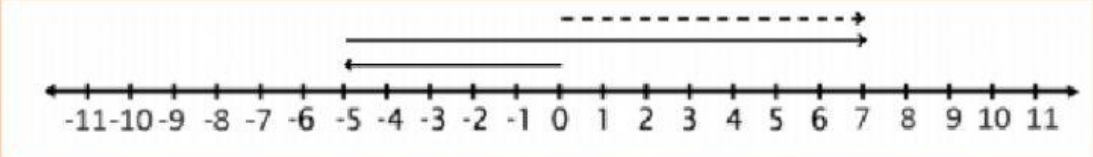

2. Ubahlah garis bilangan berikut menjadi kalimat matematika!

LIVEWORKSHEETS

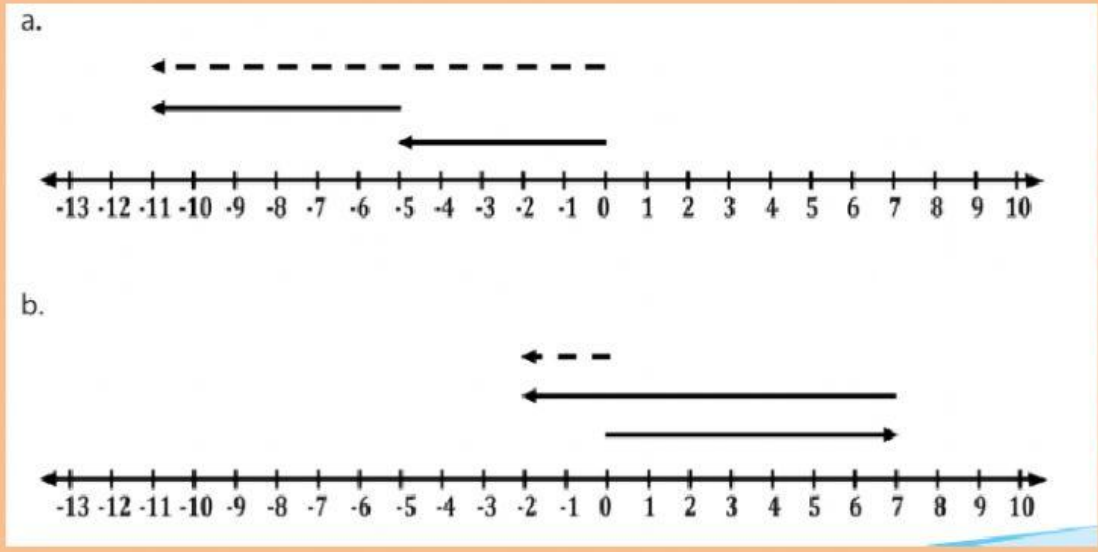

3. Tentukan hasil penjumlahan dan pengurangan bilangan bulat berikut!

   a. –12 + 7 = ...

   b. 10 – (–14) = ...

   c. –25 + (–53) = ...

   d. 15 + ... = –20

   e. ... – (–23) = 50

PILIHAN JAWABAN (Untuk soal nomer 2 dan 3)

–10 + 13 = 3
–5 + (–6) = –11
7 + (–9) = –2
24 –78 27 –35 –5

4. Sebuah bola dilemparkan ke atas hingga ketinggian 5 meter. Bola tersebut jatuh ke dalam sumur di kedalaman 4 meter. Berapa meter jarak yang ditempuh bola dari posisi awal hingga akhir?

..... - ..... = ...
..... + ... = ...

LIVEWORKSHEETS

5. Suhu badan seorang anak ketika demam 39^0C. Setelah diberikan obat penurun demam, suhu badan turun 4^0C. Tentukan suhu badan anak setelah diberikan obat.

LIVEWORKSHEETS