4TH GRADE – MATHS
DECIMALS
INTERACTIVE WORKSHEET 01

I. Write the decimal forms for the shaded portions in the figures below.

(a)  ☐

(b) ☐

(c)  ☐

II. Write the decimal forms for the un shaded portions in the figures below.

(a) ☐

(b)  ☐

(c)  ☐

III. Look at the following fractions. They have their denominator as 1000. Write them in decimal form.

a. $\frac{9}{1000}$ = ☐

b. $\frac{101}{1000}$ = ☐

c. $\frac{21}{1000}$ = ☐

d. $\frac{225}{1000}$ = ☐

e. $\frac{196}{1000}$ = ☐

f. $\frac{63}{1000}$ = ☐

g. $\frac{300}{1000}$ = ☐

h. $\frac{506}{1000}$ = ☐

i. $\frac{874}{1000}$ = ☐

j. $\frac{201}{1000}$ = ☐

k. $\frac{7}{1000}$ = ☐

l. $\frac{999}{1000}$ = ☐

ALL INDIA MATHS & SCIENCE OLYMPIAD ACADEMY
AIMS
AIMS-INDIA
LIVEWORKSHEETS