LEMBAR KERJA PESERTA DIDIK
(LKPD)

KELAS 4
SDN KLENDER 14

PECAHAN

LIVEWORKSHEETS

Masukkan gambar pecahan yang sesuai pada kotak yang disediakan!

$\frac{3}{9}$	$\frac{3}{6}$	$\frac{8}{9}$
$\frac{4}{5}$	$\frac{3}{4}$	$\frac{1}{10}$
$\frac{1}{3}$	$\frac{4}{8}$	$\frac{5}{7}$
$\frac{3}{9}$	$\frac{3}{3}$	$\frac{1}{2}$

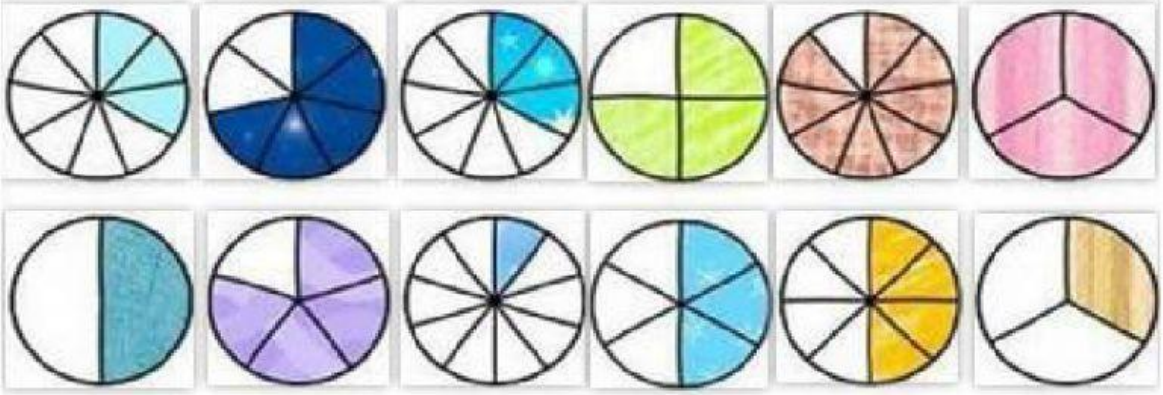

LIVEWORKSHEETS

Tentukan pecahan senilai dari pecahan yang ada!

$\frac{1}{2}$	$\frac{2}{4}$	$\frac{4}{8}$	$\frac{1}{3}$	$\frac{2}{6}$	$\frac{4}{12}$
					

$\frac{1}{2} = \frac{\square}{4}$	$\frac{1}{3} = \frac{\square}{6}$	$\frac{2}{6} = \frac{\square}{12}$
$\frac{1}{2} = \frac{\square}{8}$	$\frac{1}{3} = \frac{\square}{12}$	$\frac{2}{6} = \frac{\square}{3}$
$\frac{2}{4} = \frac{\square}{8}$	$\frac{4}{8} = \frac{\square}{2}$	$\frac{4}{12} = \frac{\square}{3}$
$\frac{2}{4} = \frac{\square}{2}$	$\frac{4}{8} = \frac{\square}{4}$	$\frac{4}{12} = \frac{\square}{6}$

LIVEWORKSHEETS

Tentukan pecahan yang paling sederhana dari pecahan di bawah ini!

1) $\frac{3}{9} = \frac{\dots}{\dots}$

2) $\frac{4}{10} = \frac{\dots}{\dots}$

3) $\frac{3}{15} = \frac{\dots}{\dots}$

4) $\frac{6}{8} = \frac{\dots}{\dots}$

5) $\frac{9}{12} = \frac{\dots}{\dots}$

6) $\frac{10}{35} = \frac{\dots}{\dots}$

7) $\frac{21}{35} = \frac{\dots}{\dots}$

8) $\frac{18}{20} = \frac{\dots}{\dots}$

9) $\frac{3}{27} = \frac{\dots}{\dots}$

10) $\frac{5}{45} = \frac{\dots}{\dots}$

LIVEWORKSHEETS

Berilah tanda < atau > sebagai perbandingan yang tepat!

1. $\frac{1}{4}$ .... $\frac{2}{4}$

2. $\frac{2}{4}$ .... $\frac{3}{4}$

3. $\frac{1}{3}$ .... $\frac{2}{3}$

4. $\frac{3}{5}$ .... $\frac{2}{5}$

5. $\frac{6}{8}$ .... $\frac{4}{8}$

6. $\frac{2}{3}$ .... $\frac{2}{4}$

7. $\frac{1}{2}$ .... $\frac{1}{3}$

8. $\frac{3}{8}$ .... $\frac{3}{6}$

9. $\frac{2}{6}$ .... $\frac{2}{4}$

10. $\frac{1}{8}$ .... $\frac{1}{6}$

LIVEWORKSHEETS