PILIH GAMBAR DAN SIMBOL YANG BETUL BAGI PENDERIA DIBAWAH DAN TAIPKAN FUNGSI DAN CONTOH KEGUNAANNYA

3 Penderia Pemasa

Bil.	Komponen	Gambar	Simbol	Fungsi	Contoh Penggunaan
1	Pemasa				

GAMBAR KOMPONEN PENDERIA

SIMBOL PENDERIA

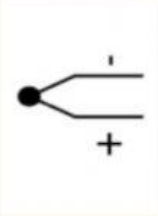
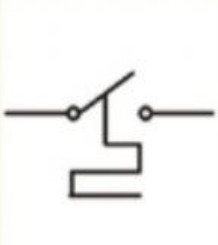
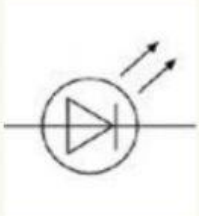

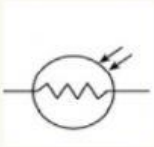

LIVEWORKSHEETS