1 Lengkapkan.

a $9 \times \square = 9$

b $1 \times \square = 1$

c $\square \times 1 = 7$

d $6 \times \square = 0$

e $5 \times \square = 0$

f $\square \times 4 = 0$

g $8 = \square \times 8$

h $0 = \square \times \square$

2 Tulis ayat matematik darab.

a

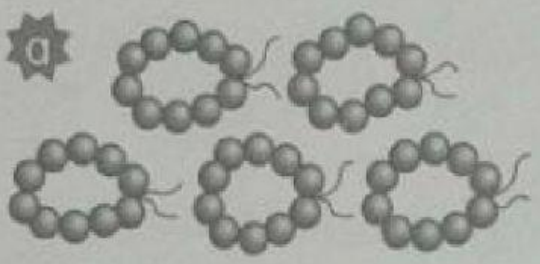

b

3 Padankan.

a	10 + 10 + 10 + 10	9 × 10	7 puluh
b	Ada 9 baris. Setiap baris ada 10 buah kerusi.	7 × 10	40
c	7 kumpulan sepuluh-sepuluh	4 × 10	90

LIVEWORKSHEETS

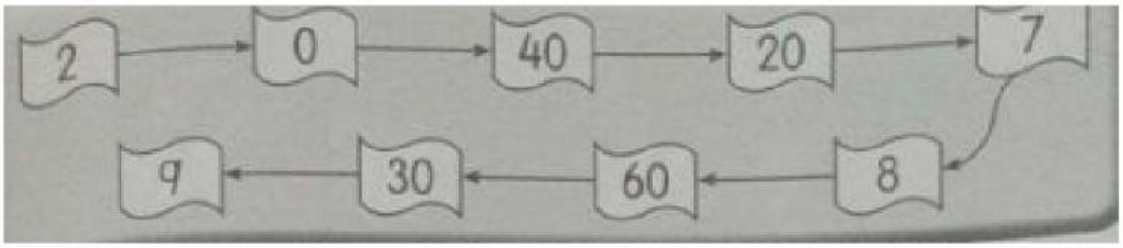

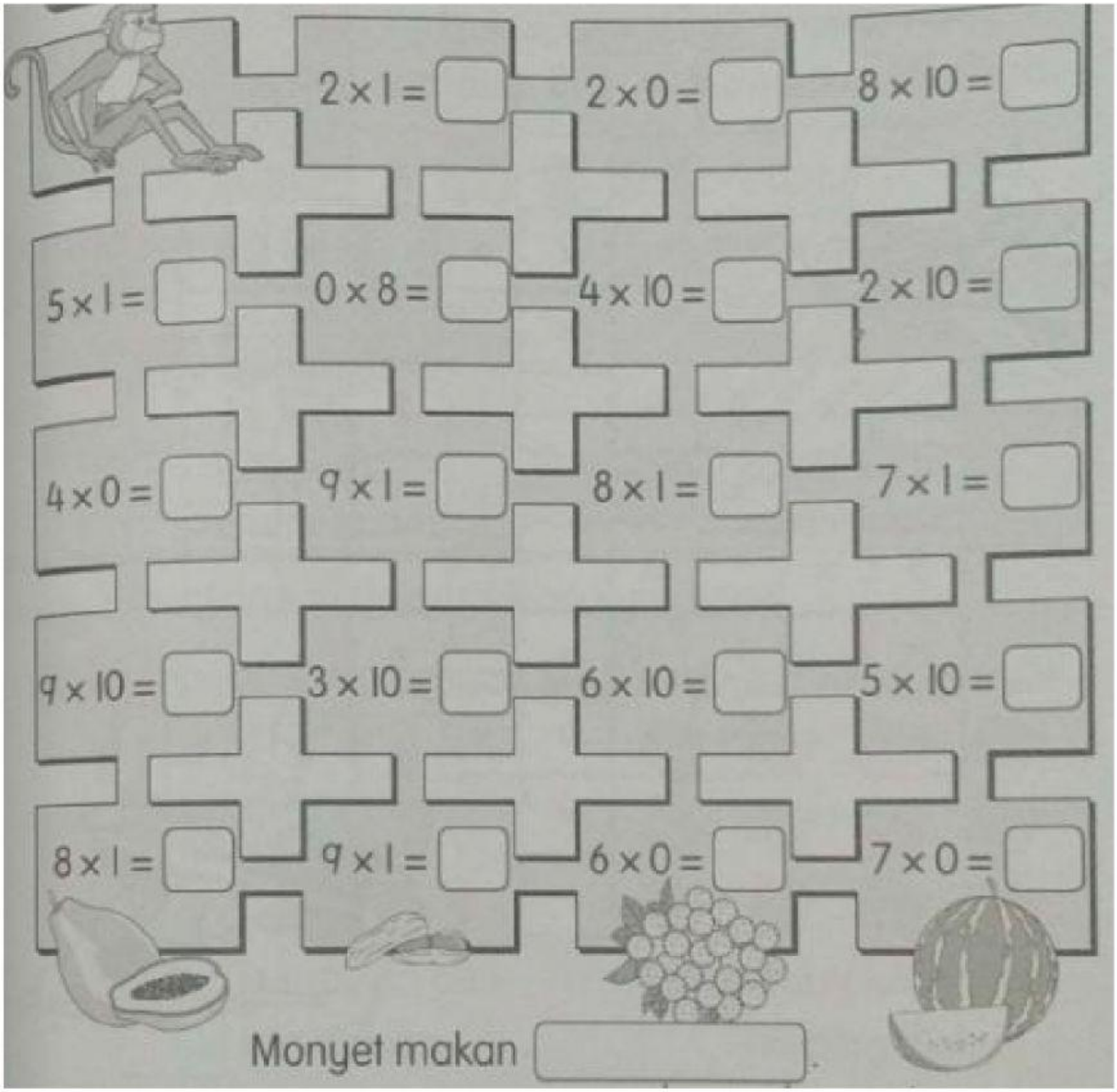

LIVEWORKSHEETS