Write the addition and multiplication sentence for the following picture..

1.

1. ____ x ____ =

____ + ____ + ____ = ____

2.

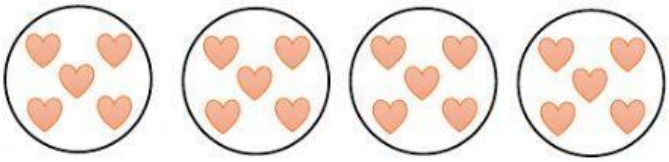

2. ____ x ____ =

____ + ____ + ____ + ____ = ____

3.



3. ____ x ____ =

____ + ____ = ____

4. ____ x ____ =

4.

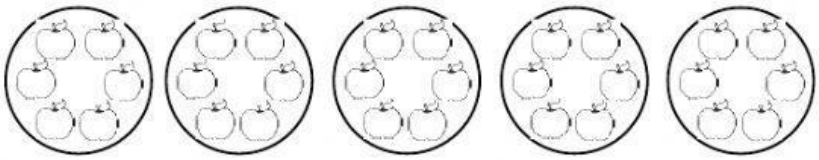

____ + ____ + ____ + ____ + ____ = ____

5.

5. ____ x ____ =

____ + ____ + ____ = ____

LIVEWORKSHEETS