LITTLE KINGS BILINGUAL SCHOOL

Midterm Math

2nd grade

III Bimester

Name:_____

- **Complete the multiplication number sentence.**

1	X	2	=	☐	3	x	9	=	☐
3	x	4	=	☐	4	x	10	=	☐
5	x	7	=	☐	2	x	7	=	☐

- **Complete the addition number sentences and the related multiplication number sentence.**

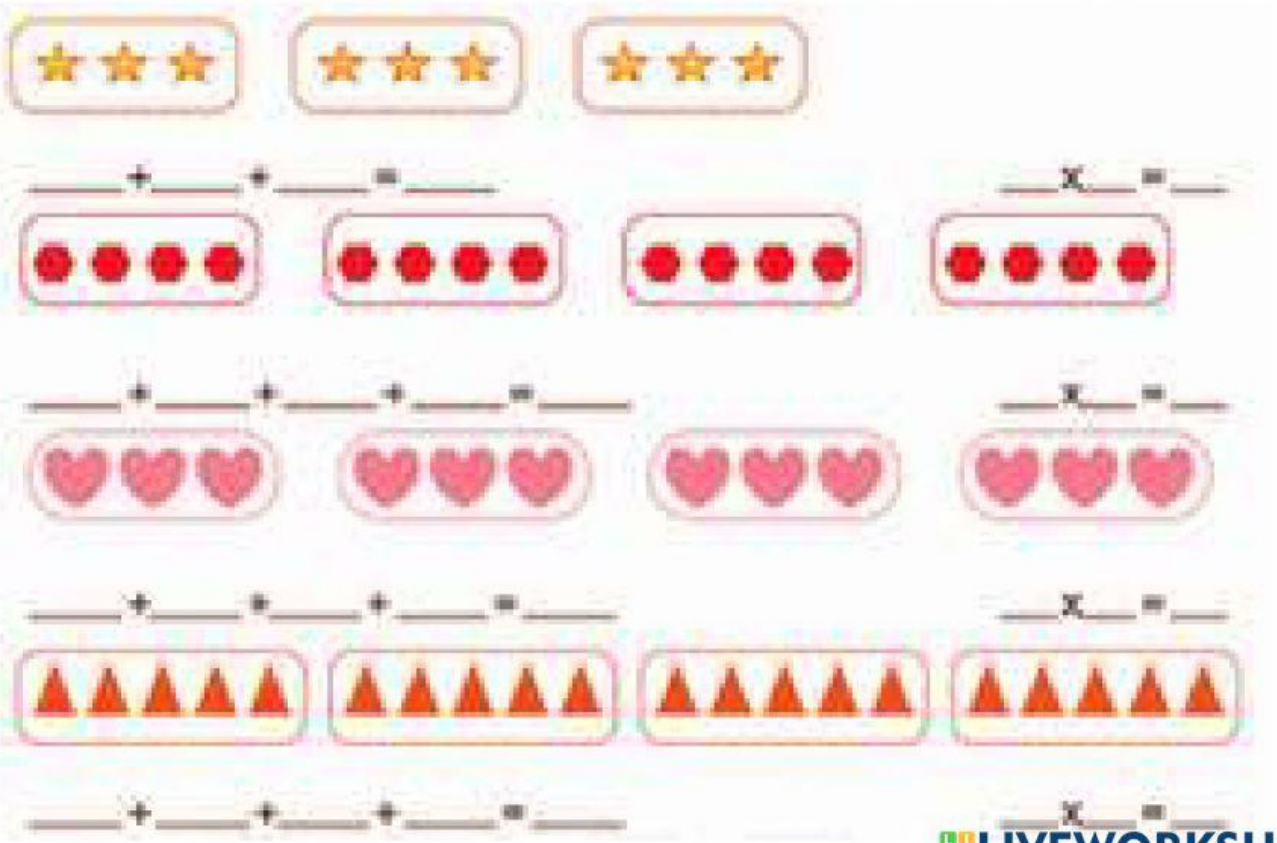

LIVEWORKSHEETS

- **Complete the addition and multiplication number sentence.**

	2+2+2=	2x3=
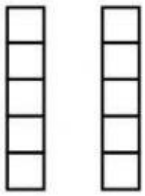	5+5=	5x2=
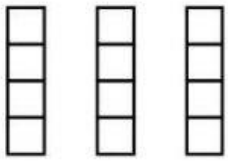	4+4+4=	4x3=
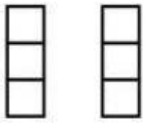	3+3=	3x2=
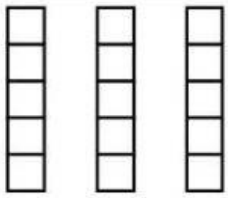	5+5+5=	5x3=

LIVEWORKSHEETS