Nama : _____

Padankan proses kitaran hidup katak dengan betul.

Telur katak

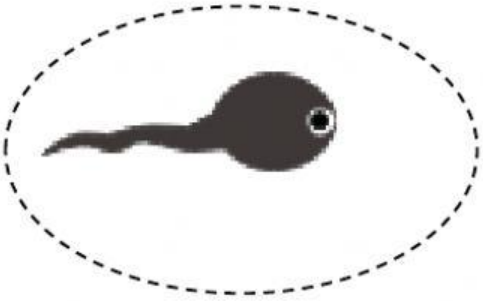

Berudu

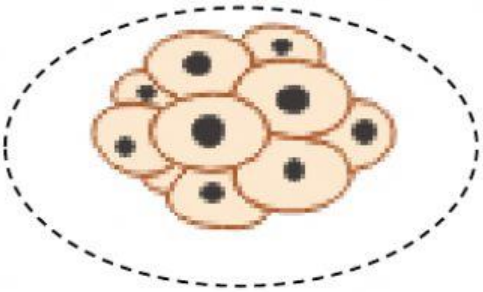

Anak katak



Berudu kaki dua



Katak dewasa

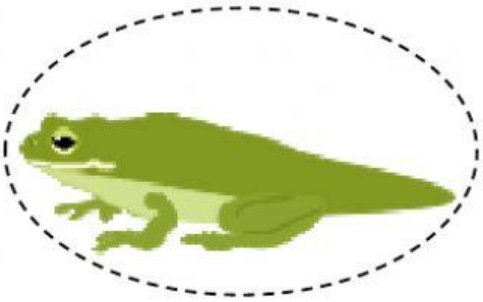

LIVEWORKSHEETS