NAMA:

KELAS:

LAKARAN-2

1. Nyatakan 3 jenis lakaran piktorial di bawah.

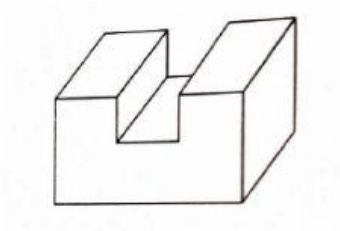

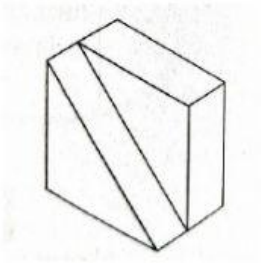

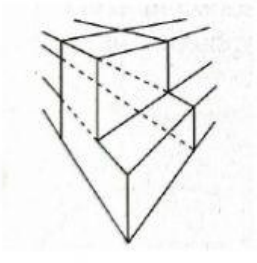

2. Nyatakan 2 jenis kaedah melakar garisan lurus.

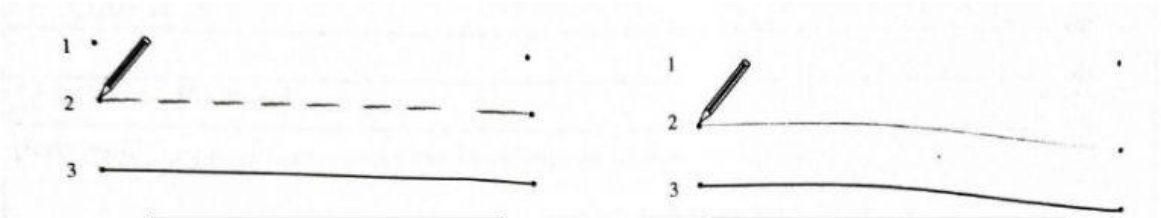

3. Pilih jawapan yang betul mengenai paksi lakaran.

Paksi mendatar | Paksi menegak | Paksi surut

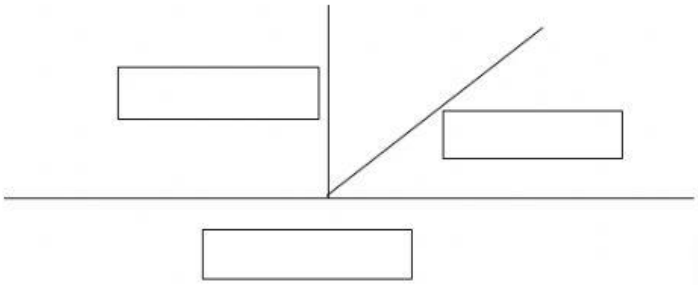

4. Pilih sudut yang betul berdasarkan lakaran.

45^0 | 30^0

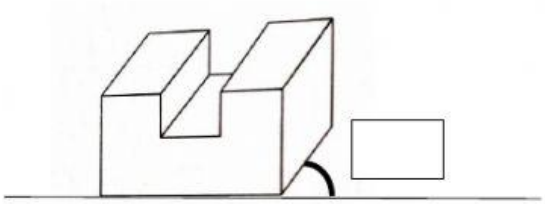

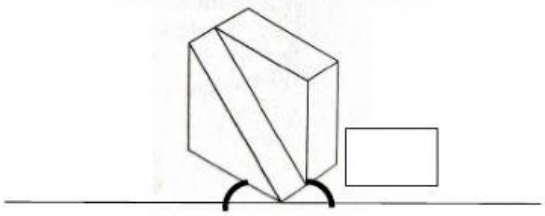

LIVEWORKSHEETS