1. ***Completa con > < =***

325 ◯ 335

390 ◯ 389

376 ◯ 375

312 ◯ 342

2. ***Resuelve y haz la prueba.***

```
  □ □ □
    2   8 □ 5
-   1   9   7
  ---------------
```

```
+   .........
    .........
  ---------------
    ...........
```

3. ***Une cada tipo de ángulo con su nombre***

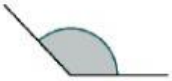

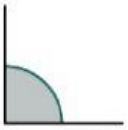

Obtuso

Recto

Agudo

4. ***Calcula el perímetro de este triángulo.***

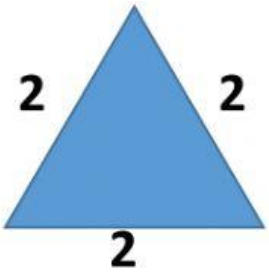

□ + □ + □ = □

LIVEWORKSHEETS