ALLFREEWORKSHEETS

1. **Prismas o pirámides**

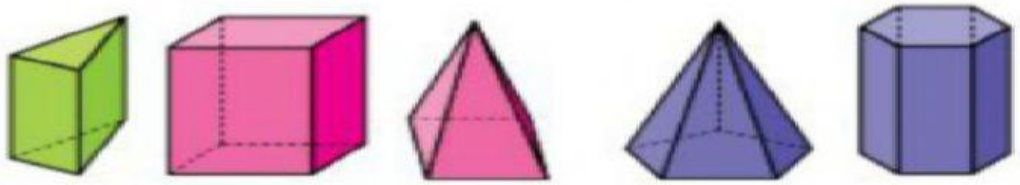

2. **¿Cómo se llaman estos poliedros?**

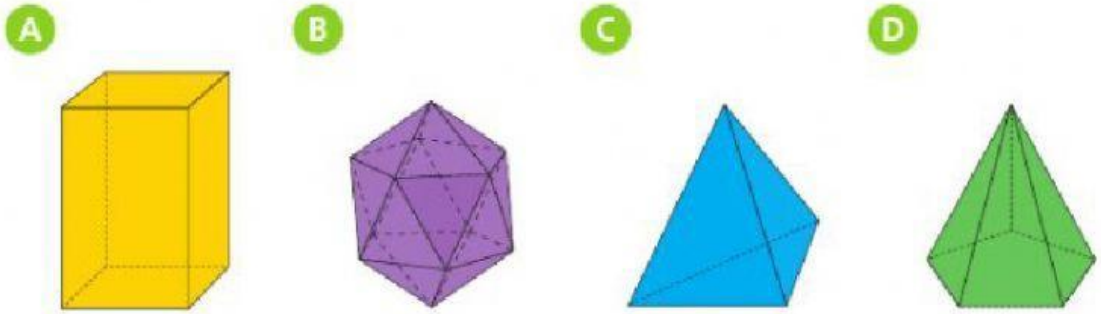

A :

C:

B:

D:

3. **Cuenta las caras, aristas y vértices de las figuras:**

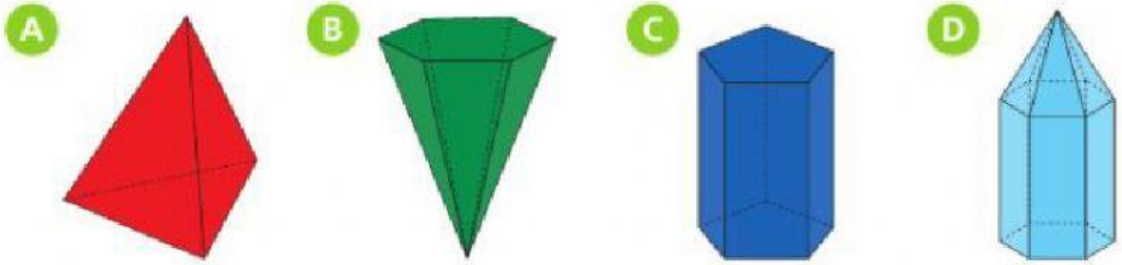

FIGURA A	Caras:	Vértices:	Aristas:
FIGURA B	Caras:	Vértices:	Aristas:
FIGURA C	Caras:	Vértices:	Aristas:
FIGURA D	Caras:	Vértices:	Aristas: