ชื่อ _____ ห้อง _____ เลขที่ _____

ให้นักเรียนจับคู่ปริมาตรที่กำหนดให้กับปริซึมให้ถูกต้อง

“84 cm^3”

“90 cm^3” “105 cm^3” “48 cm^3” “72 cm^3” “40 cm^3” “144 cm^3” “32 cm^3”

1.

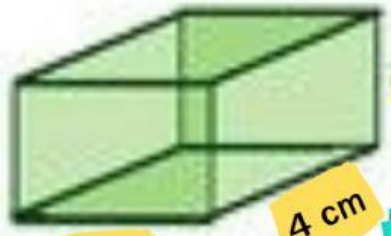

“ ”

2.

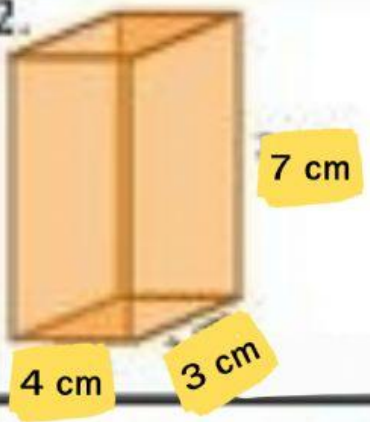

“ ”

3.

“ ”

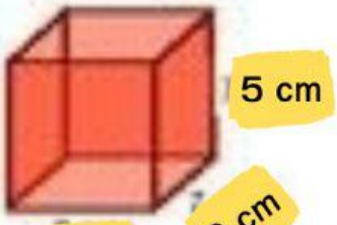

“ ”

5.

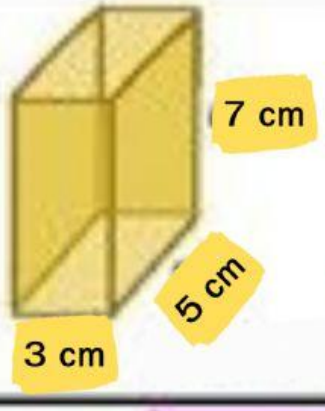

“ ”

6.

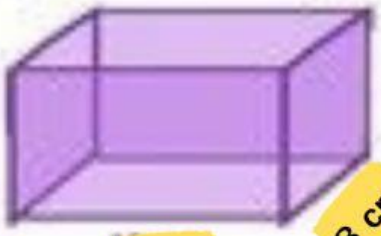

“ ”

7.

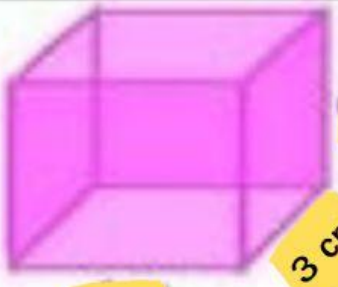

“ ”

8.

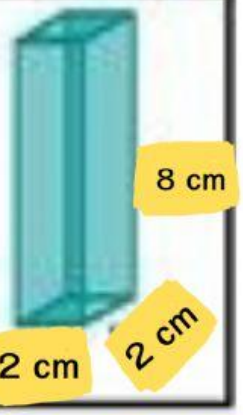

“ ”

LIVEWORKSHEETS