Compound shape

37 m^2	245 m^2	367.1 m^2
189 cm^2	212.7 cm^2	196.5 m^2
231.3 cm^2	200.5 cm^2	228.5 m^2

Find the area of each figure, round your answer to one decimal place if necessary.

1)

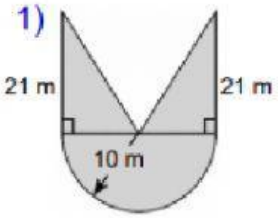

Area: _____

2)

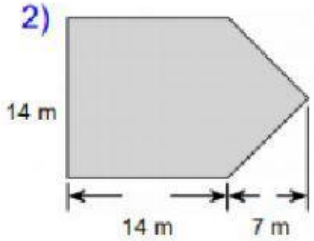

Area: _____

3)

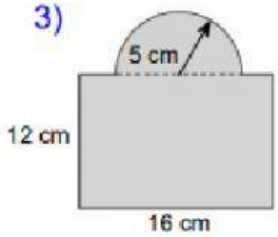

Area: _____

4)

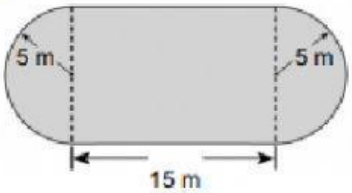

Area: _____

5)

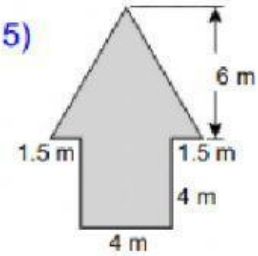

Area: _____

6)

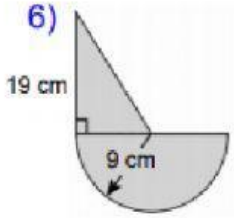

Area: _____

7)

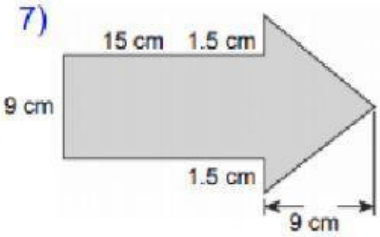

Area: _____

8)

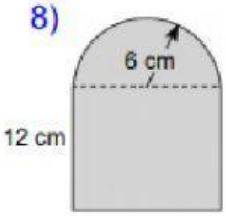

Area: _____

9)

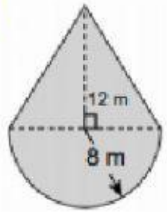

Area: _____

LIVEWORKSHEETS