Identifikasilah otot berikut sesuai dengan data yang diminta dengan memilih jawaban yang ada pada dropdown

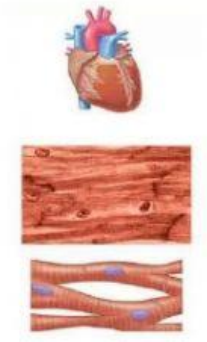

Nama Otot	
Fungsi	

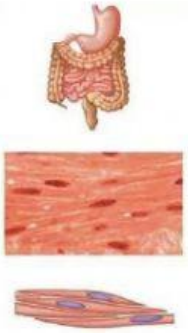

Nama Otot	
Fungsi	

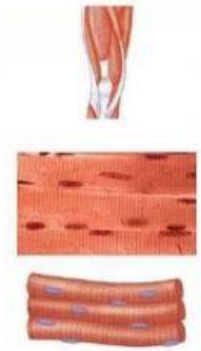

Nama Otot	
Fungsi	

LIVEWORKSHEETS