Praktis / *Practice* 4.2.2b

Tandakan (X) pada rantau yang mewakili set berikut. Boleh tanda lebih dari 1 rantau.

Contoh / Example

$A' \cup B$

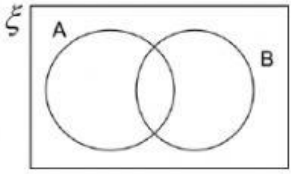

Langkah penyelesaian / *Steps to do,*

a) Nomborkan kawasan / *Number the regions.*

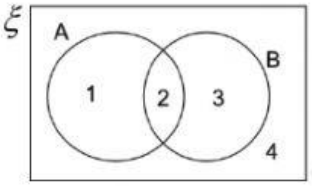

b) $A' = \{3, 4\}$

$B = \{2, 3\}$

Maka / *So,*

$A' \cup B = (2, 3, 4\}$

Tandakan X pada kawasan ini.
Shade all these regions.

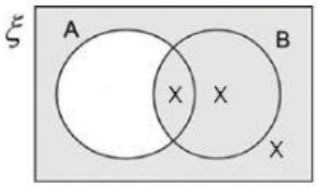

1. $A \cup B'$

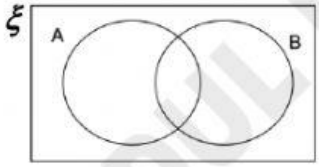

2. $A \cup B'$

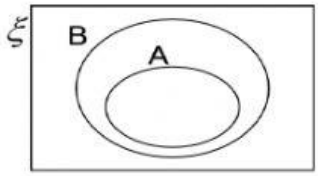

3. $A' \cup B$

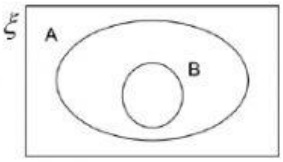

4. $A \cup B'$

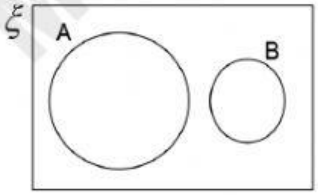

5 . $B \cup C$

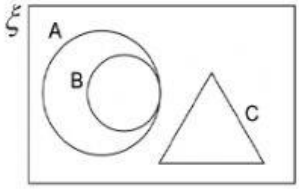

6. $A' \cup B$

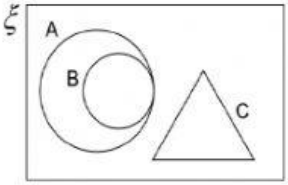

MODUL IMPAK

LIVEWORKSHEETS