NOME:

DATA: TURMA:

DOMINÓ MATEMÁTICO

ESCREVA O VALOR DE CADA DADO E REALIZE A SOMA DOS VALORES:

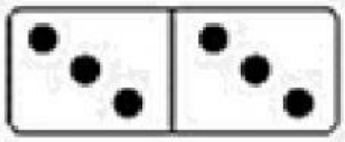

3 + 3 = 6



__ + __ = __

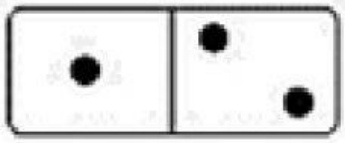

__ + __ = __



__ + __ = __



__ + __ = __



__ + __ = __



__ + __ = __

Analice Gomes

LIVEWORKSHEETS