Latihan 3 : Berdasarkan gambarajah, tuliskan dalam bentuk pecahan perseratus dan perpuluhan

1. 

Pecahan perseratus: $\frac{\square}{\square}$

Perpuluhan :_____

2. 

Pecahan perseratus: $\frac{\square}{\square}$

Perpuluhan :_____

3. 

Pecahan perseratus: $\frac{\square}{\square}$

Perpuluhan :_____

4. 

Pecahan perseratus: $\frac{\square}{\square}$

Perpuluhan :_____

BBM
Cg Azilah
LIVEWORKSHEETS