Unión e intersección de conjuntos

1. Observa los diagramas e indica si hay INTERSECCIÓN o UNIÓN.

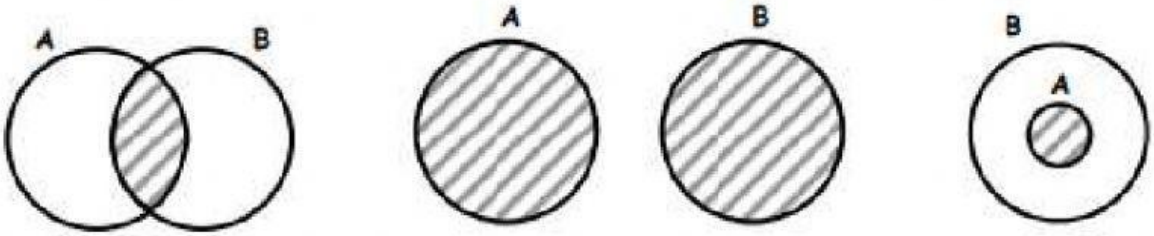

2. Observa los diagramas y completa.

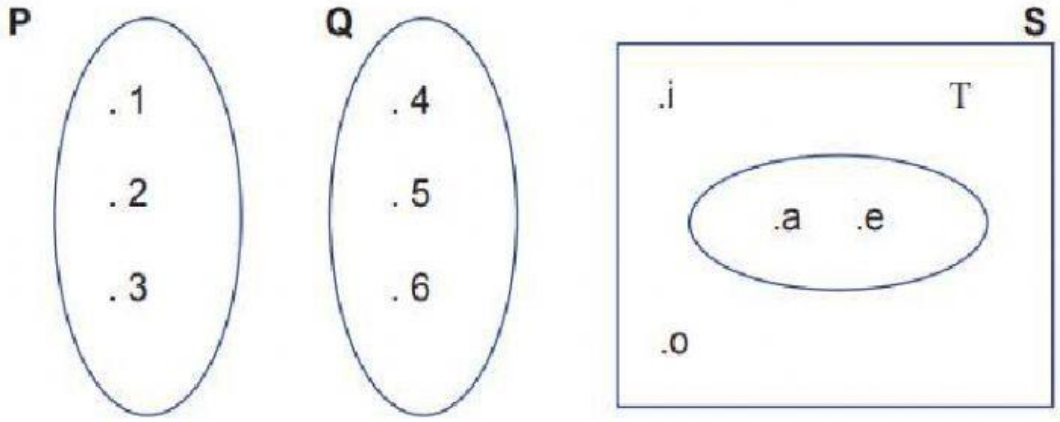

P = { _____

Q = { _____

P ∪ Q = { _____

P ∩ Q = { _____

S={ _____

T = { _____

S ∪ T = { _____

S ∩ T = { _____

LIVEWORKSHEETS

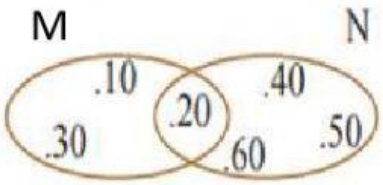

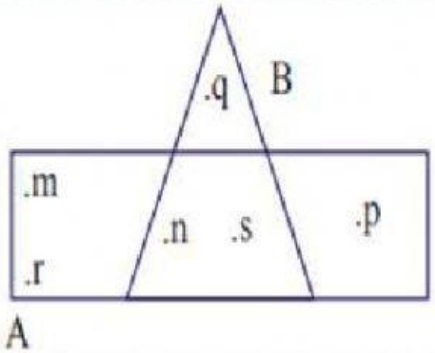

M = { _____

A = { _____

N = { _____

B = { _____

M ∪ N = { _____

A ∪ B = { _____

M ∩ N = { _____

A ∩ B = { _____

LIVEWORKSHEETS