Tajuk : Pecahan tak wajar dan nombor bercampur

Arahan :

Tulis pecahan tak wajar dan nombor bercampur bagi pecahan berikut :

1)

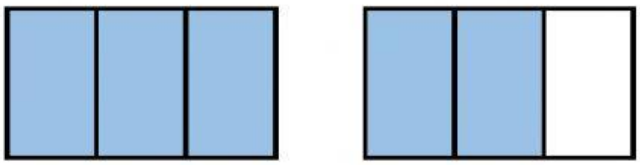

Pecahan tak wajar : $\frac{\square}{\square}$ Nombor bercampur : $\frac{\square}{\square}$

2)

Pecahan tak wajar : $\frac{\square}{\square}$ Nombor bercampur : $\frac{\square}{\square}$

3)



Pecahan tak wajar : $\frac{\square}{\square}$ Nombor bercampur : $\frac{\square}{\square}$

LIVEWORKSHEETS

4)

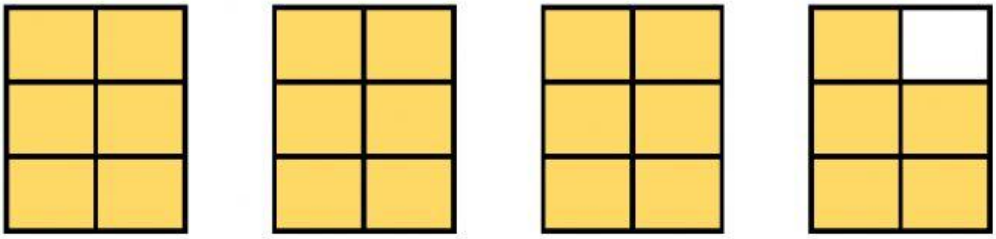

Pecahan tak wajar : $\frac{\square}{\square}$

Nombor bercampur : $\frac{\square}{\square}$

5)

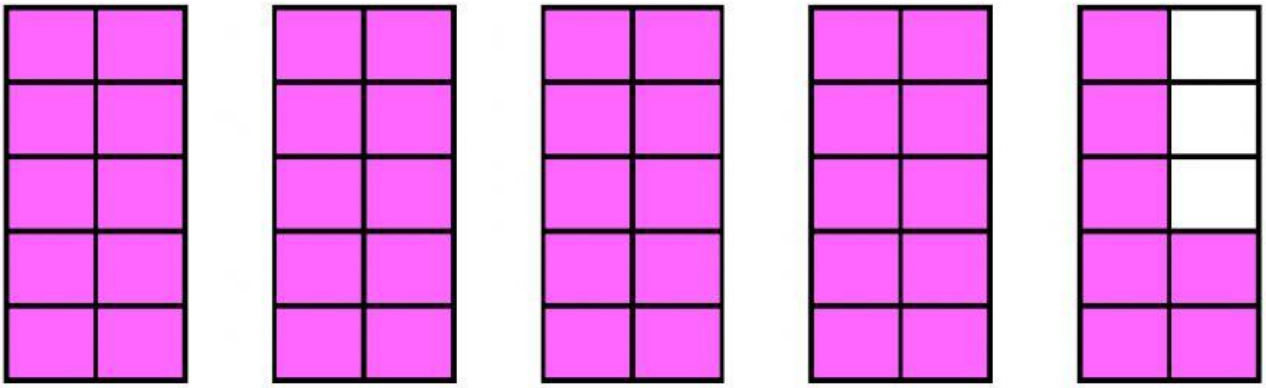

Pecahan tak wajar : $\frac{\square}{\square}$

Nombor bercampur : $\frac{\square}{\square}$

LIVEWORKSHEETS