NOME:_____

Preencha as informações referentes a cada sólido geométrico.



PIRÂMIDE DE BASE QUADRADA

Quantas faces?_____

Quantas vértices?_____

Quantas arestas?_____



CUBO

Quantas faces?_____

Quantas vértices?_____

Quantas arestas?_____



PIRÂMIDE DE BASE TRIANGULAR

Quantas faces?_____

Quantas vértices?_____

Quantas arestas?_____

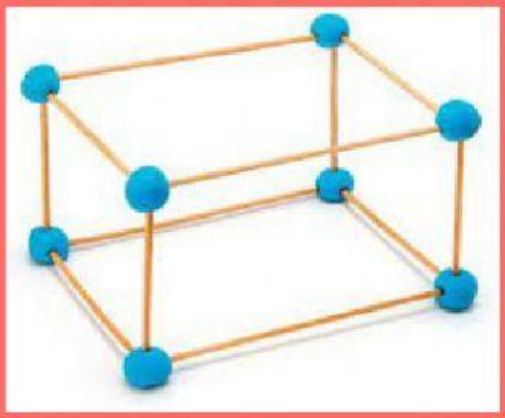

PARALELEPÍPEDO

Quantas faces?_____

Quantas vértices?_____

Quantas arestas?_____

LIVEWORKSHEETS