Sekolah Kebangsaan Senaling
72000 Kuala Pilah
N.Sembilan

Pentaksiran PBD

PENDIDIKAN MORAL

TAHUN 1

NAMA : ..... TAHUN:……..

(A) Namakan alam ciptaan Tuhan yang terdapat di bawah.

1. 

_____

2. 

_____

3. 

_____

4. 

_____

LIVEWORKSHEETS

(B) Tandakan (✓) pada perlakuan yang betul dan (X) pada perlakuan yang tidak betul.







LIVEWORKSHEETS

c)Isikan tempat kosong dengan jawapan yang sesuai mengikut amalan yang terpuji yang boleh kamu lakukan

- Baca dengan senyap
- Sila beratur
- Gunakan jejantas
- Patuhi lampu isyarat
- Pakai pakaian sopan
- Mendengar ucapan guru

1 _____

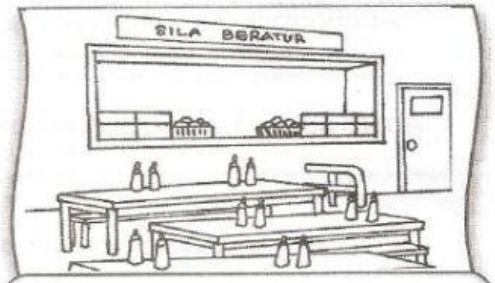

2 _____



3 _____

4 _____



5 _____



6 _____

LIVEWORKSHEETS

D) Tandakan (/) bagi perlakuan yang baik dan boleh dicontohi serta tandakan (x) bagi perlakuan yang tidak boleh dikuti. (

LIVEWORKSHEETS