NAMA: _____

PERPULUHAN (Latihan 2)

Tandakan ( / ) pada petak perseratus berlorek mengikut nilai perpuluhan berikut.

1. Sifar perpuluhan sifar sembilan



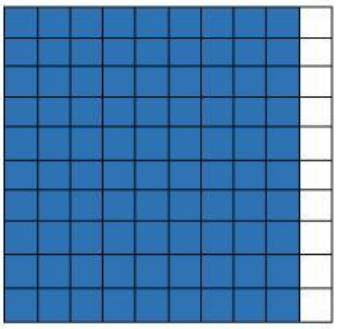

2. Sifar perpuluhan satu tujuh

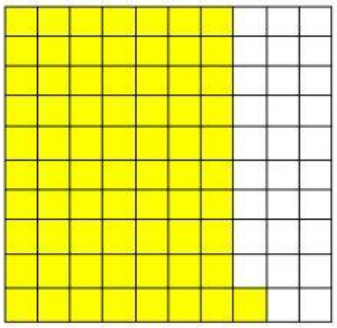

iv.

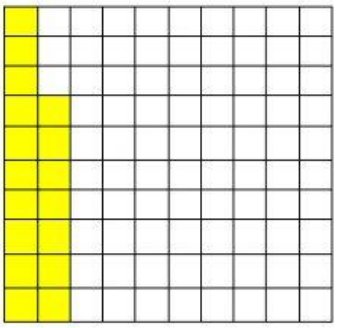

3. Sifar perpuluhan lima tiga



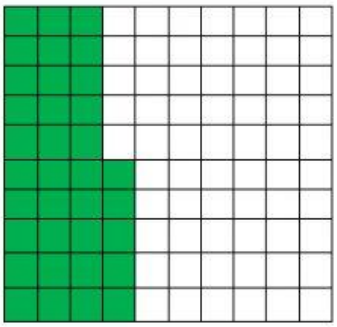

4. Sifar perpuluhan tujuh

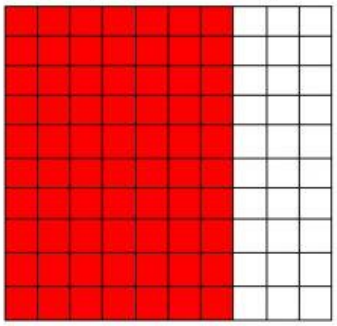

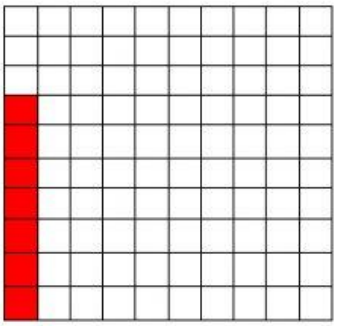

LIVEWORKSHEETS