***Kindly use Math H/W Copy to do this homework.**

H/W **Date: 8/7/21**

Q Write how many sides each shape has?(Refer to the 3-D shapes- sides and corners pdf)

a.

b.



c.

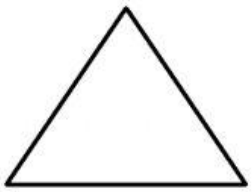

d.

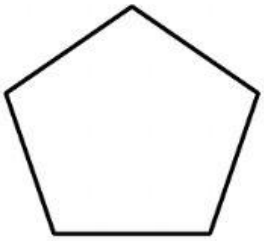

e.

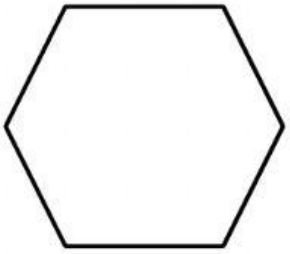

f.

LIVEWORKSHEETS