EJERCICIO DE REPASO: Centímetro-pulgada

Instrucciones: Observa cada imagen, luego escribe cuánto mide cada uno.



cm

pulgadas

cm

LIVEWORKSHEETS



cm

pulgadas



LIVEWORKSHEETS