G. Tuliskan ayat matematik pada ruang yang disediakan berdasarkan gambar rajah yang diberi.

Contoh:



$2 \times 6 = 12$

1.

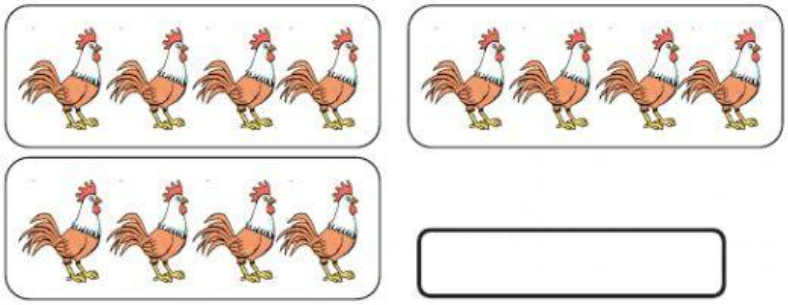

2.



LIVEWORKSHEETS