A 看图写出植物对人类和动物的重要性。 SP 5.1.1

J 美化环境　K 使环境凉爽　L 可用作药物
M 提供食物　N 提供庇护所　O 提供制造物品的材料



选择正确的答案

1. 明华想要计算弟弟跑完操场一圈所用的时间。以下哪个测量工具可以帮助他计算时间？

A

B

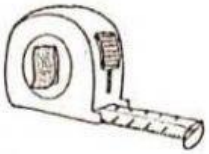

C

2. 当我们读取读数时，眼睛的视线应该在哪个位置？

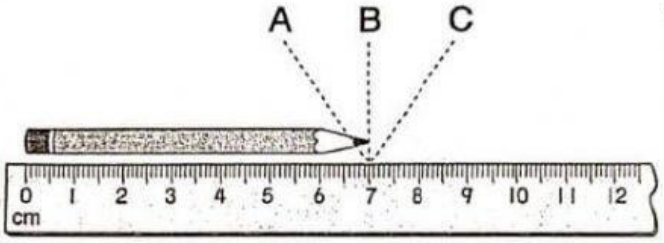

3. 明翰想测量自己的体重，他应该使用哪种测量工具来测量？

A

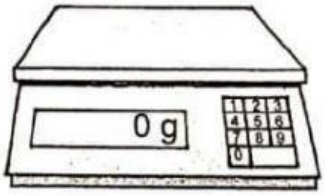

B

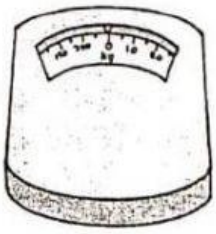

LIVEWORKSHEETS