Sumar centenas completas a números de tres cifras

200 + 425 = 425 + 200

200 + 194 =	400 + 527 =	500 + 216 =
700 + 218 =	800 + 161 =	300 + 363 =
600 + 355 =	200 + 784 =	100 + 235 =
100 + 721 =	600 + 239 =	400 + 456 =
300 + 468 =	300 + 443 =	800 + 118 =
400 + 242 =	200 + 458 =	200 + 593 =
500 + 473 =	100 + 776 =	700 + 141 =
800 + 136 =	700 + 295 =	300 + 672 =
100 + 687 =	500 + 212 =	600 + 224 =
200 + 787 =	100 + 187 =	100 + 387 =

LIVEWORKSHEETS

Completa la tabla.

×	2	3	4	5	6	7	8	9	10
2									
8									
5									
10									

Calcula el perímetro de las siguientes figuras.

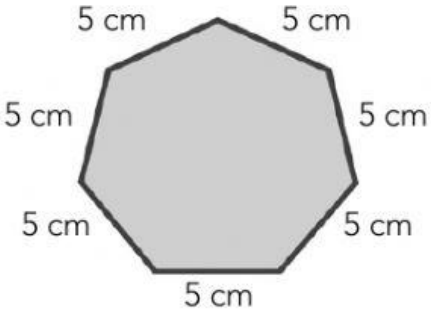

Perímetro = ☐ cm

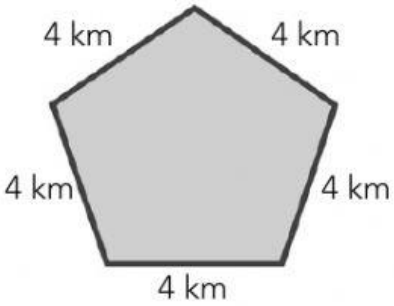

Perímetro = ☐ km

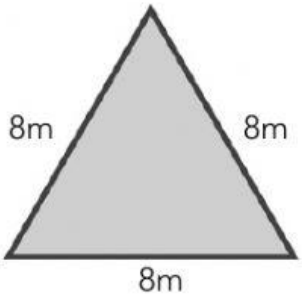

Perímetro = ☐ m

Inventa un problema a partir de la imagen.



☐

☐

☐

☐

☐

☐

LIVEWORKSHEETS