SESC – CENTRO EDUCACIONAL DE TERESINA
"JOSÉ ALVES DE SOUSA NETO"
Rua Santa Catarina, 285 – Bairro Ilhotas.

Escola:_____

Nome:_____Data:_____

Professora: Luiza Helena / Francisca Rodrigues – 2º Ano Manhã e Tarde.

ATIVIDADE DE MATEMÁTICA

1. Com base no que estudamos, escreva se os objetos abaixo são poliedros ou não poliedros.

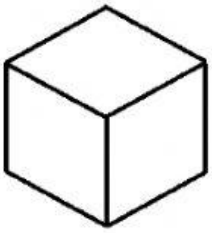

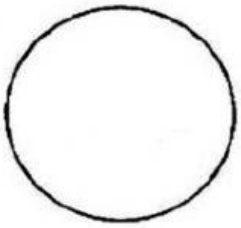

_____ _____ _____



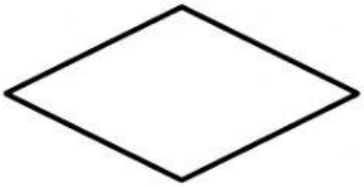

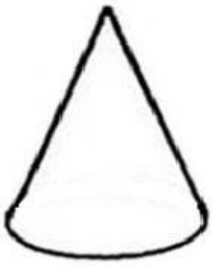

_____ _____ _____

2. Marque (1) no que é poliedro e (2) no que é redondo.

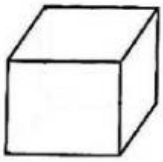

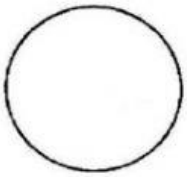

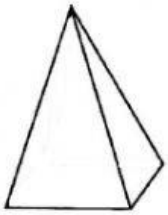

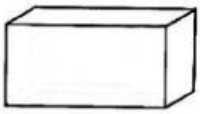

☐ ☐ ☐ ☐ ☐ ☐

LIVEWORKSHEETS

3. Observe os poliedros e complete a tabela:

Forma geométrica	Número de faces (F)	Número de vértices (V)	Número de arestas (A)	Número de faces + número de vértices (F + V)	Número de arestas + 2 (A + 2)
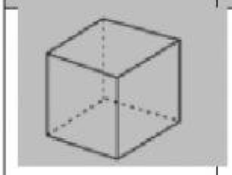					
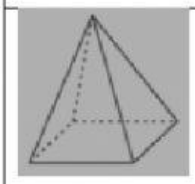					
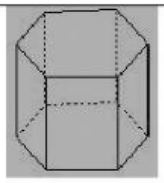					
					
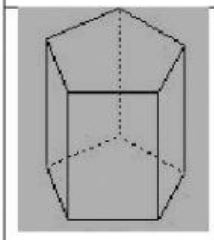					

LIVEWORKSHEETS