Standard One

Science

SECTION 1 – Multiple Choice

Choose the correct answer.

1. A vertebrate is an animal _____

   a. with a backbone c. with four legs

   b. without a backbone d. with scales

2. Which of the following animals is a mammal?

a) 

b) 

c)

d)

3. The best method to separate sand and marbles is

a) handpicking b) mixing c) throwing d) grabbing

LIVEWORKSHEETS

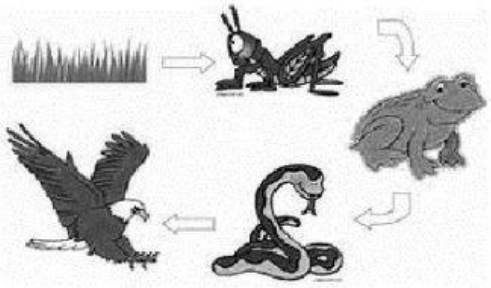

4. From the above picture, what is this called?

a) Food chain b) Eco-system c) Food web d) Daily

5. Herbivores eat mainly _____.

a. Animals b. Plants c. Plants and animals d. Dead matter

6. Bear eats berries and small animals like fish. They are _____.

a. Carnivore b. Herbivore c. Omnivore d. Reptiles.

7. Humans who eat chicken, turkey and vegetables come under _____.

a. Carnivore b. Herbivore c. Omnivore d. Scavenger.

8. Dogs, Cats, Lions, Tigers, Sharks, Snakes eat meat. They are_____.

a. Carnivore b. Herbivore c. Omnivore d. Scavenger.

9. Circle which **ONE** of these animals is a Scavenger?



a. Hyena

b. Frog

c. Parrot



d. Fish

LIVEWORKSHEETS

10. The wind is:

a. Something that can be tasted. b. Moving air.

c. Something we can see. d. No moving air.

SECTION 2

Complete the table below by listing **3 Living things** and **3 Non living things**.

Living Things	Non-Living Things

LIVEWORKSHEETS

SECTION 3

Using the pictures given. Write the name of the animals in box below in the correct appropriate column.

whale **frog** **jelly-fish** **worms** **parrot** **crab**

Vertebrate	Invertebrate
1)	
2)	
3)	

SECTION 4

A force is an action carried out to change the position of an object.

Use the words **push**, **squeeze**, **pull** and **twist** to describe the force shown in the picture.



LIVEWORKSHEETS

SECTION 5

Write the names of the two habitats below.

Terrestrial **aquatic**

_____ _____

Section 6 – Use the words below to make a food chain. Write the word inside the correct boxes.

bird

grass



worm

LIVEWORKSHEETS

SECTION 7

Write **True** or **False** next to the correct sentence.

a) There are six different Daily cycles. _____

b) A simple machine makes our job easier. _____

c) In Trinidad and Tobago, Local scientist are not important. _____

d) All birds cannot fly. _____

e) Dr Joseph was the first to discover that rabies can be spread to other animals and humans by vampire bats. _____

f) We cannot see the force. _____

LIVEWORKSHEETS

SECTION 8

B. Fill in the blanks with the words from the box.

Aquatic habitats	**eco-system**		**Habitat**	**Windmill**		
Force	**Pulley**	**Sunny**	**windy**	**stormy**	**rainy**	**cloudy**

1. A _____ is used for wind energy
2. A _____ is a strength or power.
3. The _____ is a simple machine that uses grooved wheels and a rope.
4. _____ are ponds, rivers and lakes.
5. During the _____weather we must stay indoors.
6. I love to go to the beach on a _____ day.
7. Keera love to watch the shape of the clouds on a _____day.

LIVEWORKSHEETS

SECTION 9

Using the list words in the box label the correct weather shown.

lightning	cloudy	windy	rainy	sunny

_____ _____ _____

LIVEWORKSHEETS