ATIVIDADES

1) Complete os quadros:

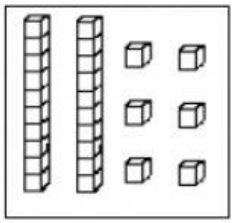

.... barrinhas e .... cubinhos

..... dezenas e ..... unidades

..... + ... = ...

.....

.....

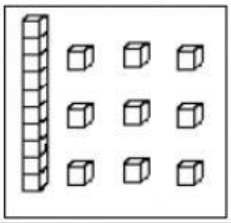

.... barrinhas e .... cubinhos

..... dezenas e ..... unidades

..... + ... = ...

.....

.....

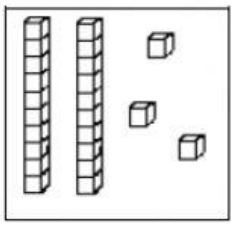

.... barrinhas e .... cubinhos

..... dezenas e ..... unidades

..... + ... = ...

.....

.....

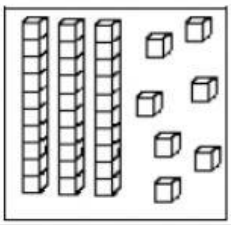

.... barrinhas e .... cubinhos

..... dezenas e ..... unidades

..... + ... = ...

.....

.....

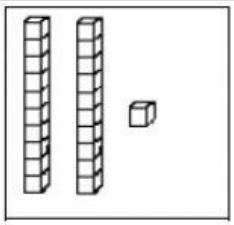

.... barrinhas e .... cubinhos

..... dezenas e ..... unidades

..... + ... = ...

.....

.....

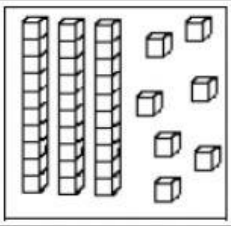

.... barrinhas e .... cubinhos

..... dezenas e ..... unidades

..... + ... = ...

.....

.....

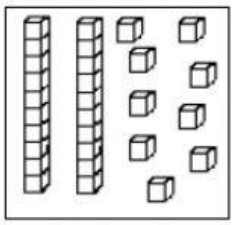

.... barrinhas e .... cubinhos

..... dezenas e ..... unidades

..... + ... = ...

.....

.....

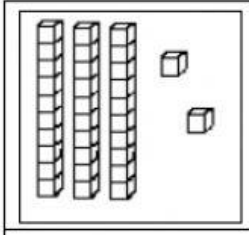

.... barrinhas e .... cubinhos

..... dezenas e ..... unidades

..... + ... = ...

.....

.....

2) Complete as sequências:

1ª sequência

10 ....

2ª sequência

25 ....

LIVEWORKSHEETS