Tipos de enlace del carbono

Nombre: _____ Undécimo grado

Instrucciones: Agrupe y arrastre los ejemplos del lado izquierdo de enlace simple, doble o triple al grupo correspondiente del lado derecho.

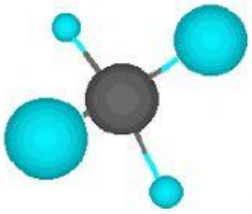

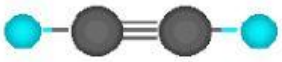

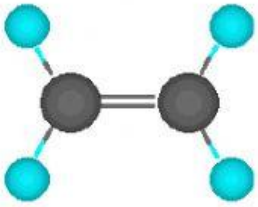

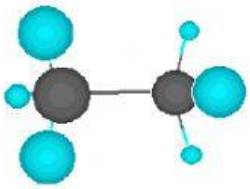

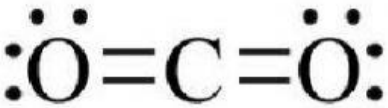

ENLACE SIMPLE

ENLACE DOBLE

ENLACE TRIPLE

LIVEWORKSHEETS