KENALI NILAI TEMPAT DAN NILAI DIGIT

Aktiviti 1

Bilang dan tulis nombor.

a



puluh	sa
3	4

34

b

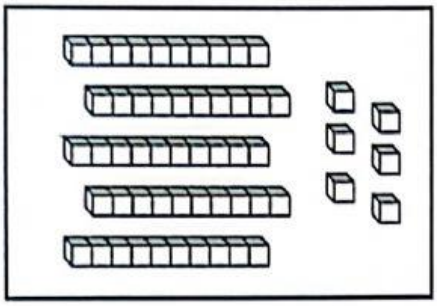

puluh	sa

c

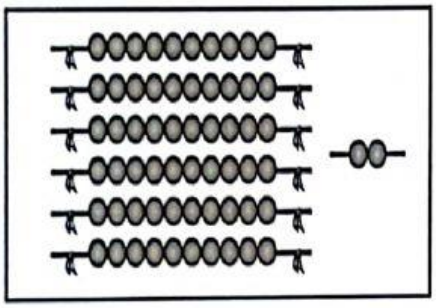

puluh	sa

d

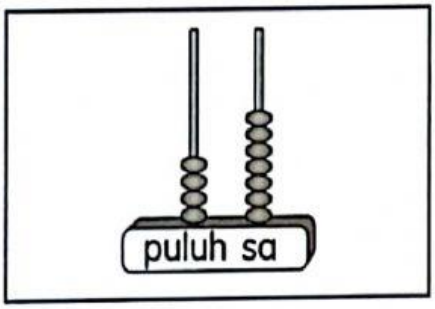

puluh	sa

e



puluh	sa

LIVEWORKSHEETS