Centro Educacional Thuty

Nome : _____

4 ° ano DATA: 18 / 06 / 2021

- **Perímetro** é a soma das medidas dos lados de um polígono.

Ex:

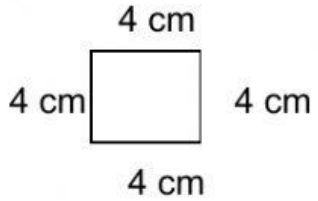

P = l + l + l + l
P = 4 + 4 + 4 + 4
P = 16 cm

→ P = perímetro

1- Determine o perímetro dos polígonos abaixo:

a)

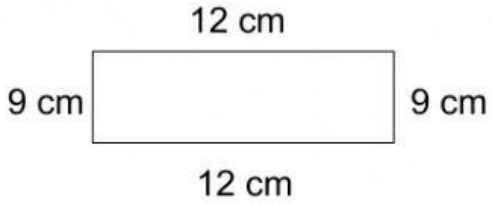

P = _____

P = _____

b)

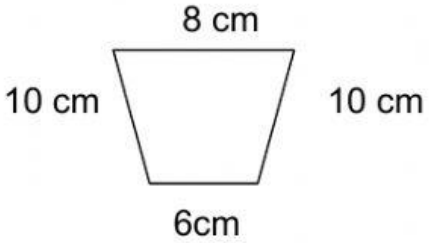

P = _____

P = _____

c)

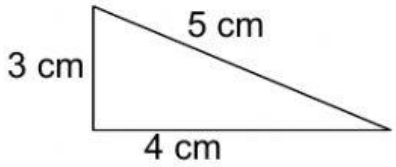

P = _____

P = _____

2- Responda:

a) O que é um quadrilátero?

_____

_____

b) Como os quadriláteros estão divididos?

_____

LIVEWORKSHEETS