NOME: _____

DATA: _____/ _____/ _____

CONTE OS PONTOS DO DOMINÓ E RESOLVA AS CONTINHAS.
SIGA O EXEMPLO.

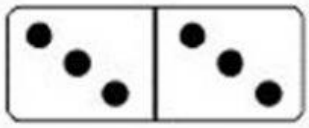

3 + 3 = 6



___ + ___ = ___

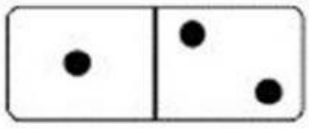

___ + ___ = ___



___ + ___ = ___



___ + ___ = ___



___ + ___ = ___



___ + ___ = ___



___ + ___ = ___



___ + ___ = ___

LIVEWORKSHEETS