Nama :

Arahan : Pilih jawapan yang betul berdasarkan gambar

tan θ

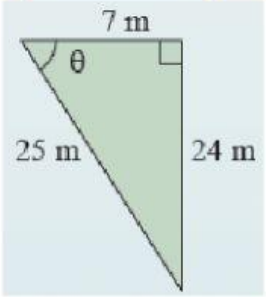

$\frac{7}{25}$ $\frac{24}{25}$ $\frac{24}{7}$

sin θ

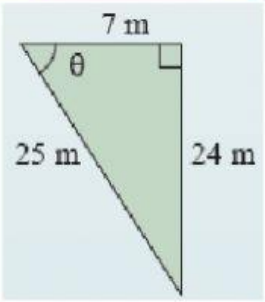

$\frac{7}{25}$ $\frac{24}{25}$ $\frac{24}{7}$

kos θ

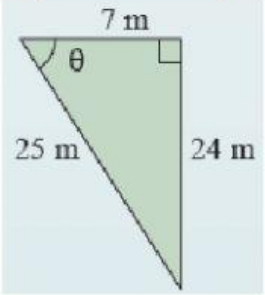

$\frac{7}{25}$ $\frac{24}{25}$ $\frac{24}{7}$

sin θ

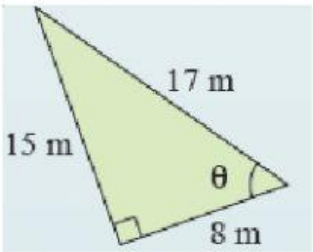

$\frac{8}{15}$ $\frac{8}{17}$ $\frac{15}{17}$

kos θ

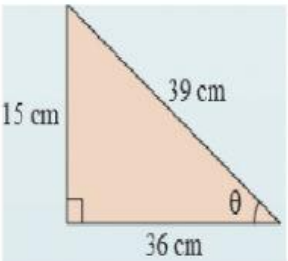

$\frac{36}{39}$ $\frac{15}{39}$ $\frac{15}{36}$

tan θ

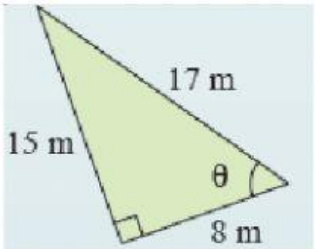

$\frac{8}{17}$ $\frac{15}{17}$ $\frac{15}{8}$

LIVEWORKSHEETS