Mathematics
Number 20

Counting by 2's
Drag and drop the numbers in correct order.

8	14	10	2	18
16	20	6	12	4



LIVEWORKSHEETS

Number 20 (Grouping)

Sets of **2 pencils**. 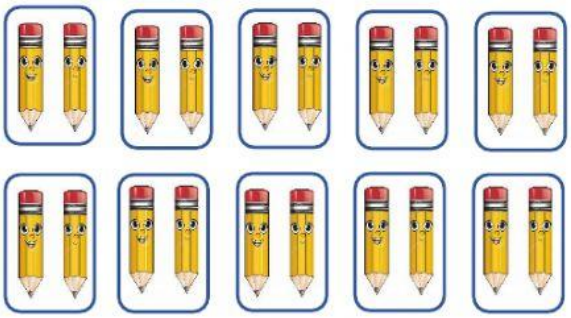 There are _____sets of 2 pencils in a set of 20 pencils. _____ sets of 2 equals 20.	Sets of **4 cars**. There are _____ sets of 4 cars in a set of 20 cars. _____sets of 4 equals 20.
Sets of **5 flowers**. There are _____ sets of 5 flowers in a set of 20 flowers. _____ sets of 5 equals 20.	Sets of **10 apples**.  There are _____ sets of 10 apples in a set of 20 apples. _____ sets of 10 equals 20.

LIVEWORKSHEETS

Number 20
Money word problems

Four friends went to Zariah's restaurant to buy food.
Answer the following questions. **Remember to write your number statements.**
Do not type the dollar signs for the number statements.

One slice of Pizza	Burger	Snack	Hotdog	Drink	Lollipop
$10	$12	$4	$8	$6	$2

1. Rashad bought a **burger** and **hotdog**.
   What was his **total** bill?

   _____

2. Kasey-Ann bought **a slice of pizza**, **snack** and **drink**.
   What was her **total** bill?

   _____

3. Travis bought **2 slices of pizza.**
   What was his **total** bill?

   _____

4. Jermiyah bought **a slice of pizza**, **hotdog** and **lollipop**.
   What was her **total** bill?

   _____

LIVEWORKSHEETS