Colegio Nourish

2020-2021 _____

June Exam **2nd Grade**

Science

Name: _____ **List #** _____

Date: _____ **Teacher: Jovita Rodríguez**

I. Choose the correct answer. (1-5)

Habitat water, air, and sun Ocean data hypothesis

_____ is the largest body of water. It covers most of Earth.

_____are the needs of the plants.

_____is the place where a plant or animal lives.

Scientists use their senses to collect _____.

The possible answer to a question is the _____.

II. Choose the correct answer. (6-8)

Matter is anything that_____.

a) Takes up space and has mass b) reflects light c) has electricity

The properties of a dry sponge are_____.

b) delicious b) heavy c) small, rough, and square

Tool that measures temperature.

a) Ruler b) measuring cup c) thermometer

LIVEWORKSHEETS

III. Match the states of the matter. (9-11)

liquid

gas

solid

IV. Choose the correct answer. (12-14)

Mammals, birds, fish, reptiles, and amphibians are in the group of_____.

a) Backbones b) without backbones

Insects and spiders are in the group of _____.

a) Backbones b) without backbones

_____passes from one living thing to another.

a) Habitat b) food chain

LIVEWORKSHEETS

V. Drag and drop. Parts of the plant. (15-17)

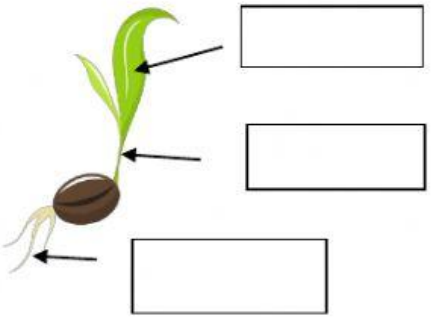

leaf

root

stem

VI. Match if the animal has backbones or not backbones. (18-19)

backbones

Not backbones

VII. Choose the correct answer. (20-22)

Is the use of Science to solve problems:

a) Data b) technology c) solid

Glasses, cars, pencil, microwave, and X-rays are_____.

a) Technology b) not technology

LIVEWORKSHEETS

Is a tool that can make work easier:

a) Machine b) habitat

VIII. Match the simple machines. (23-27)

wedge



screw

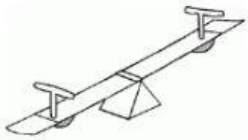

Inclined plane

lever

pulley



IX. Write 3 different parts of your body that you can use as a tool. (28-30)

_____, _____, and _____.

LIVEWORKSHEETS