1. Yang manakah lengkok minor bagi bulatan ini?

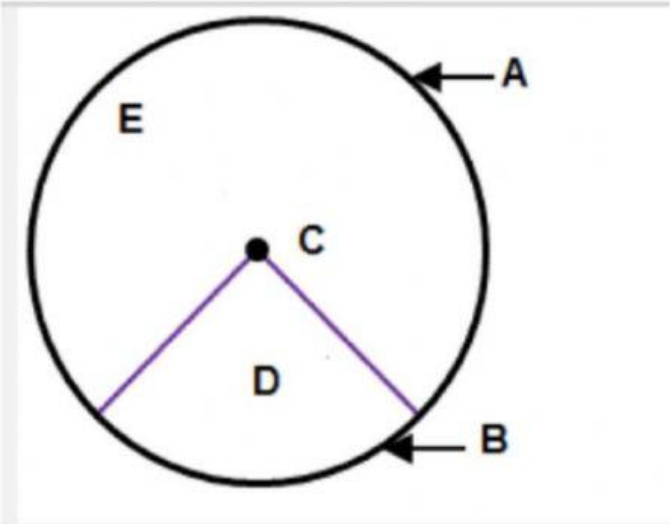

- A
- B
- D
- E

2. Yang manakah jejari bagi bulatan ini?

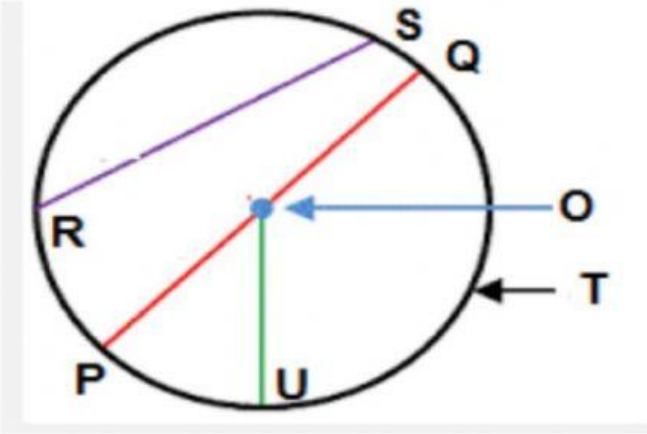

- QP
- RS
- OU
- PU

3. Yang manakah jejari bagi bulatan ini?

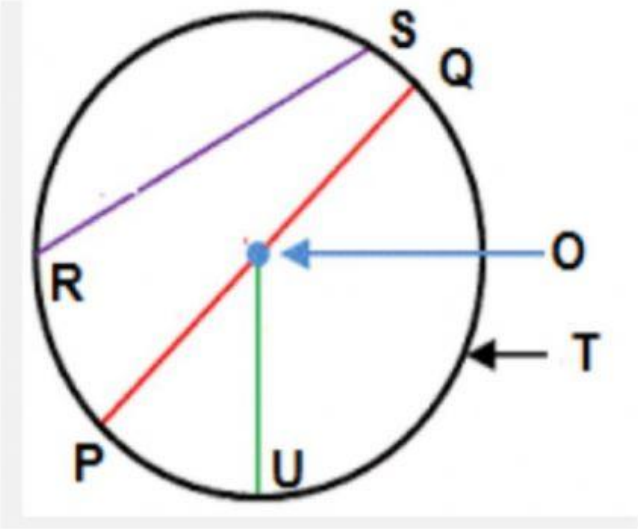

- QP
- RS
- OU
- PU

4. PQ ialah _____ bagi bulatan ini.

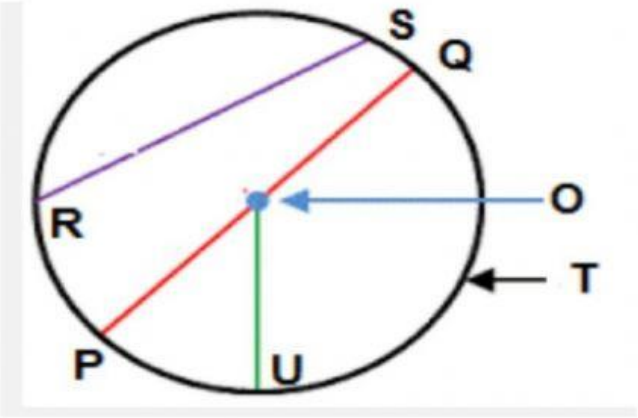

- Diameter
- Jejari
- Tembereng
- Perentas

LIVEWORKSHEETS

5. Namakan bahagian RS.

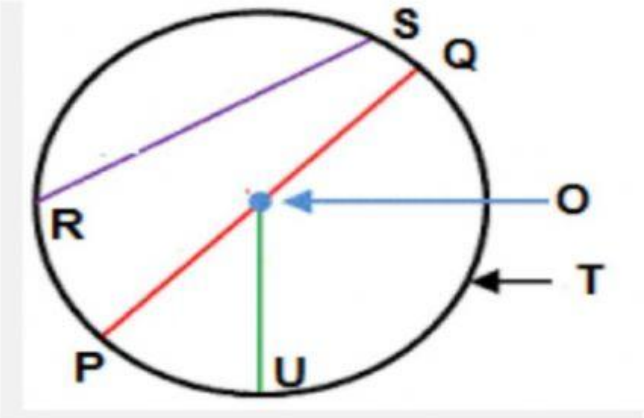

- Diameter
- Jejari
- Tembereng
- Perentas

6. Namakan bahagian C.

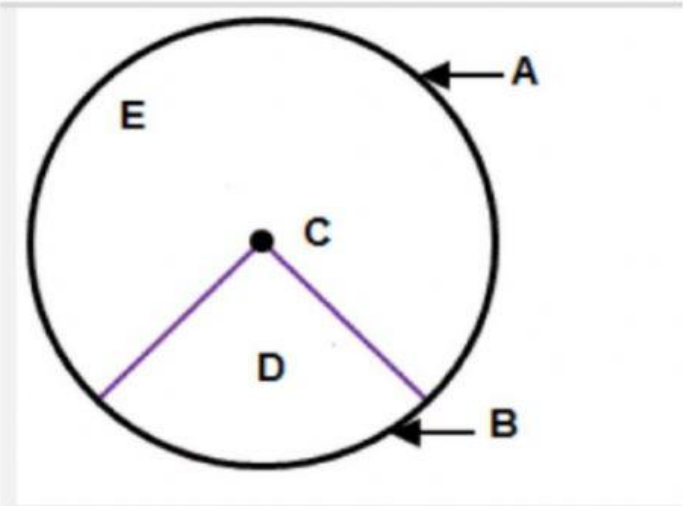

- Lilitan
- Pusat
- Tembereng
- Jejari

7. Diameter adalah gabungan 2 jejari

- betul
- salah

LIVEWORKSHEETS

8. PADANKAN JENIS-JENIS BULATAN DIBAWAH

DB	DO	DOA	O
DE/ EA	DBC	DOE/ AOE	ABCDE

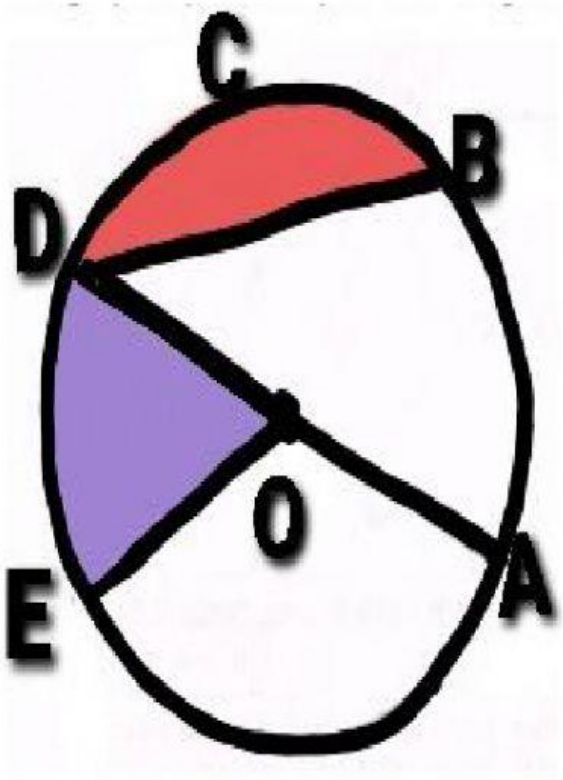

Bahagian-bahagian bulatan

a) Jejari .....

b) Diameter .....

c) Perentas .....

d) Lilitan .....

e) Pusat .....

f) Sektor .....

g) Lengkok .....

h) Tembereng .....

LIVEWORKSHEETS