# Volumen de los cuerpos geométricos

Nombre del alumno (a):_____

Calcula el volumen de los siguientes prismas.

| PRISMAS | PROCEDIMIENTO | RESULTADO |
|---|---|---|
| 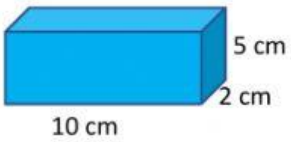  | V= _____ X _____ X _____ | V= _____ |
| 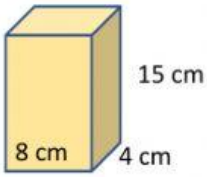  | V= _____ X _____ X _____ | V= _____ |
| 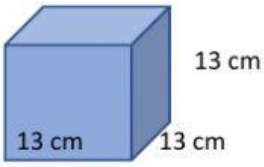  | V= _____ X _____ X _____ | V= _____ |
| 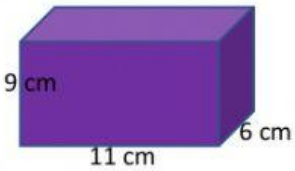  | V= _____ X _____ X _____ | V= _____ |
| 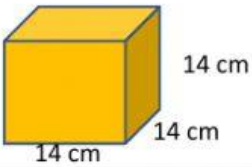  | V= _____ X _____ X _____ | V= _____ |

LIVEWORKSHEETS