Friday 11th June, 2021
Term 3
Weekly Test 7- Mathematics

A. Follow the instructions carefully.

1. Count and write the number of objects in the box.
2. Then, drag and drop the correct sign to compare the sets.

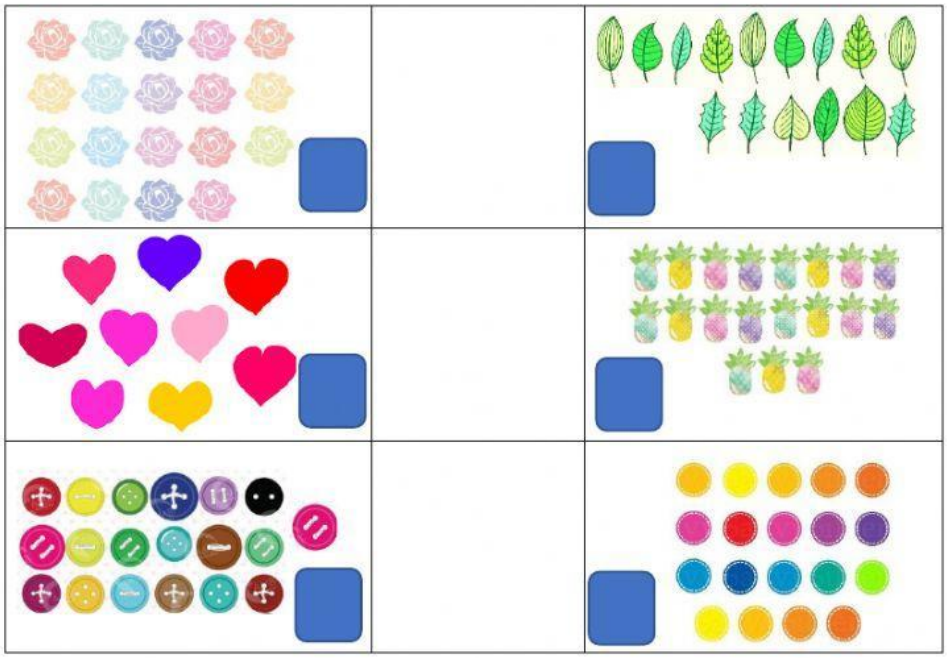

B. Complete the magic triangle.

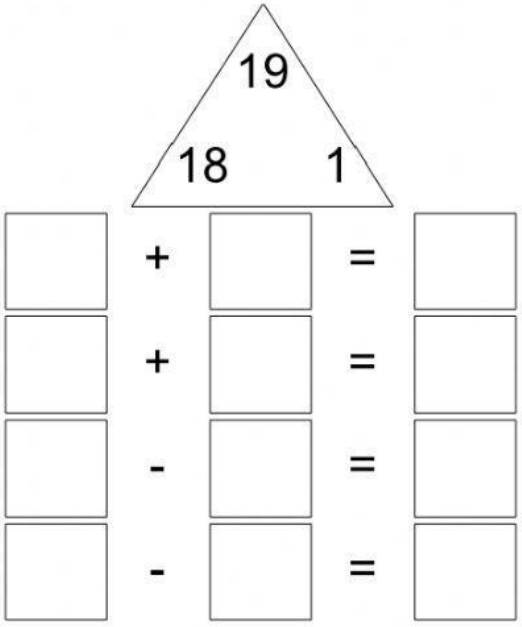

LIVEWORKSHEETS

C. Fill in the missing money to make **$19** in both wallets.



LIVEWORKSHEETS

D. Three students went to Jada's store to buy school supplies.
Answer the following questions. **Remember to write your number statements. Do not type the dollar signs for the number statements.**

Book	Colouring book	Puzzle	Crayons
			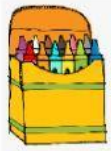
$12	$10	$15	$8

1. Zahirah had **$19**.
   She bought a **puzzle** at the store.
   How much money she had **left**?

   _____

2. Che had **$19**.
   He bought a **book** at the store.
   How much money he had **left**?

   _____

3. Cataleya had **$19**.
   She purchased a **colouring book** and **crayons** at the store.

   1) What is the **total cost** of the **colouring book** and **crayons**?

   _____

   2) How much money she had **left**? _____

LIVEWORKSHEETS