# 平面圖形

- 數一數，有幾條邊 ╲ ？

| | | | |
|---|---|---|---|
| | 4 | 5 | 8 |
| | 3 | 7 | 6 |
|  | 2 | 8 | 7 |

LIVEWORKSHEETS

| | | | |
|---|---|---|---|
| | 7 | 3 | 4 |
| 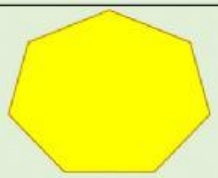 | 7 | 5 | 6 |
| 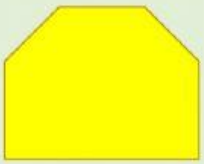 | 3 | 6 | 9 |
|  | 2 | 5 | 7 |

LIVEWORKSHEETS