**Nombre:** _____

**Fecha:** _____ **Curso:** _____

# Ecuaciones con balanza (1)

1. Escribe la ecuación que representa cada balanza y encuentra el número que corresponda a la incógnita en cada caso.

a.

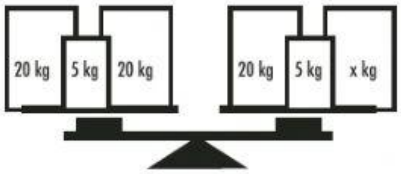


**Ecuación:**_____

X:_____

b.

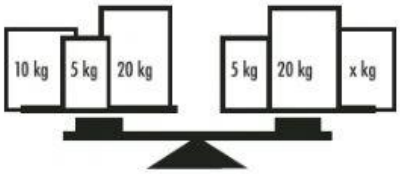


**Ecuación:**_____

X:_____

c.

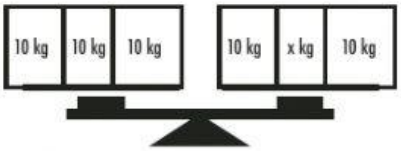


**Ecuación:**_____

X:_____

d.

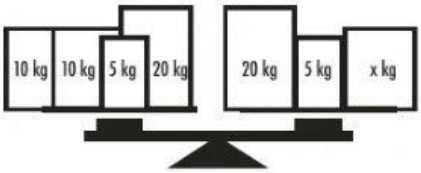


**Ecuación:**_____

X:_____

2. Determina el valor de x, y luego, comprueba:

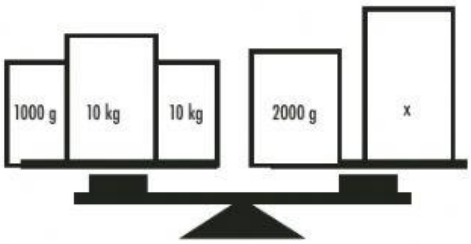


www.recursosdocentes.cl

LIVEWORKSHEETS