REPASO BLOQUE VI MATEMÁTICAS

1. Resuelve las siguientes potencias.

$4^3 =$ $7^2 =$ $5^4 =$ $3^5 =$ $2^6 =$ $10^4 =$

2. Descompón en forma de potencia de base 10.

- 48.302= X + X + X +
- 7.005.641= X + X + X + X +
- 271.003= X + X + X +
- 196.201.006= X + X + X + X + X +

3. De qué número se trata?

$7 \times 10^6 + 5 \times 10^4 + 8 \times 10^2 + 6 =$

$5 \times 10^7 + 3 \times 10^6 + 2 \times 10^5 + 6 \times 10^3 + 4 \times 10^1 =$

$9 \times 10^5 + 5 \times 10^3 + 4 \times 10^2 + 3 \times 10^1 + 7 =$

$3 \times 10^8 + 8 \times 10^6 + 1 \times 10^4 + 5 \times 10^2 + 4 \times 10^1 =$

4. Resuelve la siguiente operación:

$(5^3 + 2^4) + 6^2 \times 4^3 - 2^5 =$

5. Cambio de unidades:

$5\ km^2 =$	m^2	$75\ dam^2 =$	km^2
$12\ hm^2 =$	cm^2	$0{,}82\ dam^2 =$	dm^2
$5{,}4\ cm^2 =$	m^2	$7\ km^2\ 59\ dam^2\ 3\ m^2 =$	m^2
$63{,}585\ m^2 =$	dm^2	$29\ hm^2\ 15\ m^2\ 8\ cm^2 =$	cm^2

LIVEWORKSHEETS

6. Calcula el área de las siguientes figuras: (SOLO PON EL RESULTADO NO LA MEDIDA)

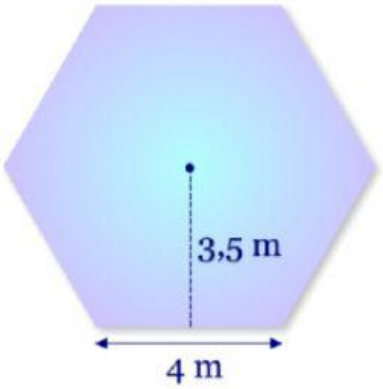

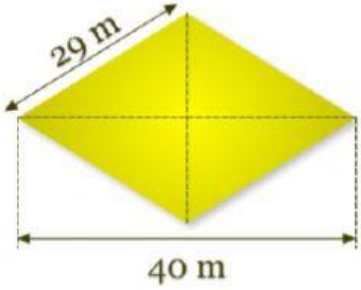

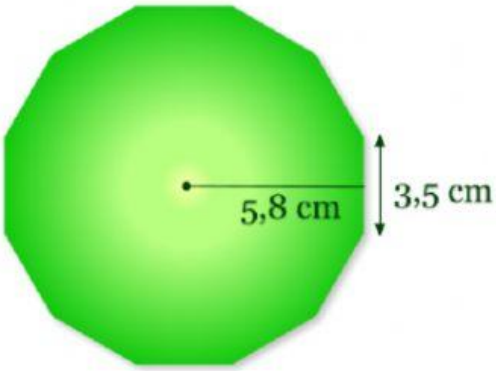

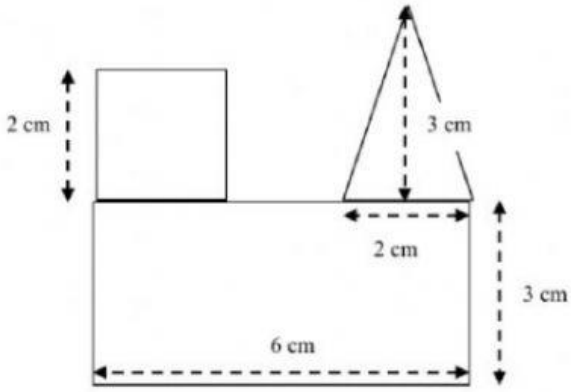

7. Completa el siguiente esquema sobre los cuerpos geométricos

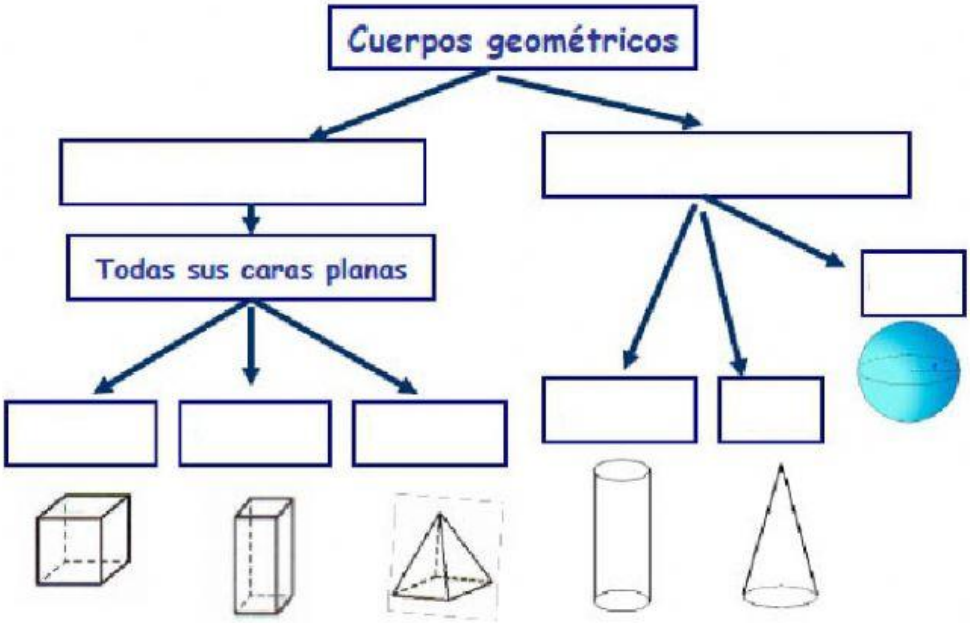

LIVEWORKSHEETS