Señala el nombre correcto para estos compuestos:

1. 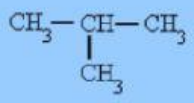

- a) metilpropano
- b) butano
- c) propilmetano

2. 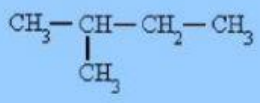

- a) pentano
- b) etilpropano
- c) metilbutano

3. 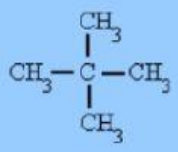

- a) tetrametilmetano
- b) dimetilpropano
- c) pentano

4. 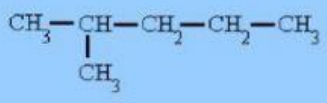

- a) dimetilbutano
- b) 2-metilpentano
- c) 4-metilpentano

5. 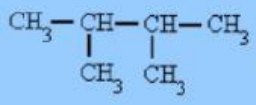

- a) 2,3-metilbutano
- b) 2,3-dimetilbutano
- c) 2,3-dietilbutano

6. 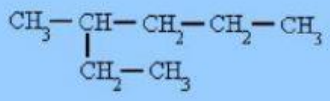

- a) 2-etilpentano
- b) 2-propilbutano
- c) 3-metilhexano

7. 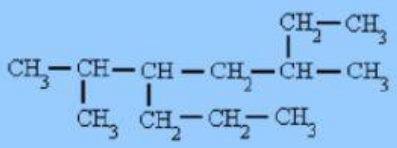

- a) 2-metil-3-propil-5-etilhexano
- b) 5-etil-2-metil-3-propilhexano
- c) 5-isopropil-3-metiloctano

8. 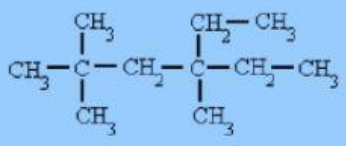

- a) 4-etil-2,2,4-trimetilhexano
- b) 3-etil-3,3,5-trimetilhexano
- c) 4-etil-2,2,4-metilhexano

9. 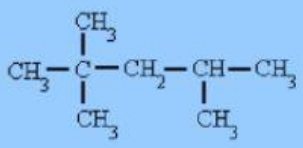

- a) 2,2,4-tetrametilpentano
- b) 2,2,4-trimetilpentano
- c) 2,2-dimetil-4-metilpentano

10. 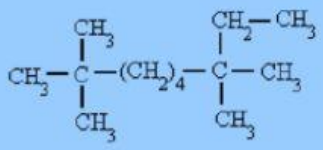

- a) 7-etil-2,2,7-trimetiloctano
- b) 2-etil-2,7,7-trimetiloctano
- c) 2,2,7,7-tetrametilnonano

Fuente: alonsofórmula

LIVEWORKSHEETS